Hangisinin sayısı daha azdır? Eşleştirerek bulalım. Sayısı az olanı ☑ işareti ile işaretleyelim.

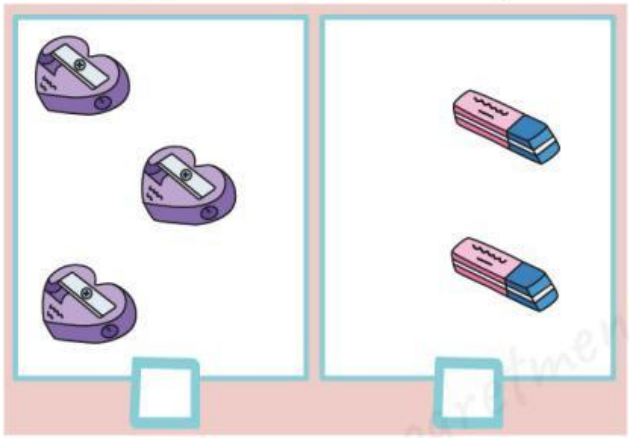

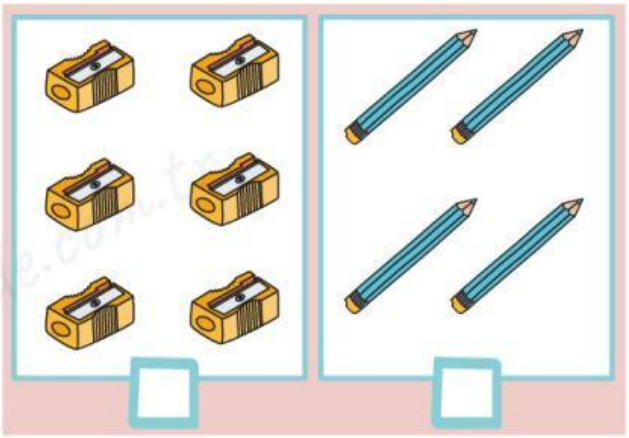

Hangisinin sayısı daha çoktur? Eşleştirerek bulalım. Sayısı çok olanı ☑ işareti ile işaretleyelim.

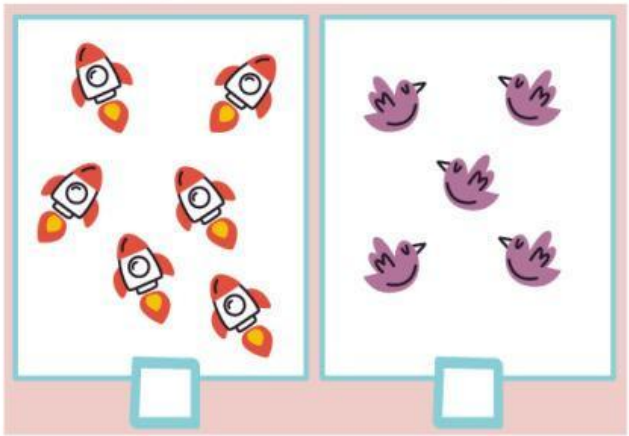



Hangi çerçevedeki şekillerin sayısı birbirine eşittir? ☑ işareti ile işaretleyelim





LIVEWORKSHEETS

Sayısı birbirine eşit olan nesnelerin kutularını işaretleyelim.

















LIVEWORKSHEETS