Last Name: _____	First name: _____	Period: _____	Date: _____

Question 1

Find the missing angle of a Quadrilateral.

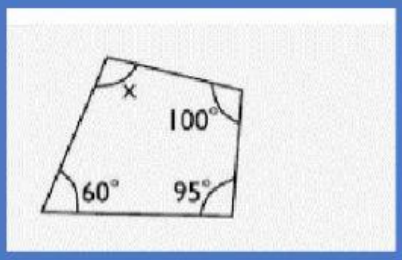

1st Add 100° + 60° + 95° = _____°

2nd Subtract 360° - _____° = _____°

_____

Question 2

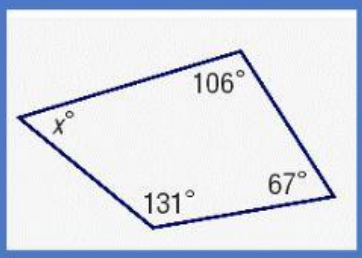

1st Add 106° + 67° +131° =

2nd subtract 360°

3rd Answer= _____°

Question 3

Find the missing angle.

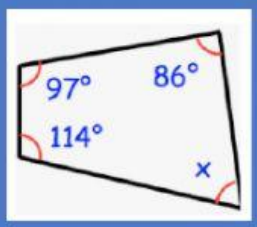

360° - (sum of the angles) ° = _____

LIVEWORKSHEETS

Question 4

1. How much do Strawberries cost per pound?

2. How much do California Mandarins cost per pound?

3. How much is chicken breast per pound?

4. How much are blueberries per pound?

5. How much per pound are grapes?

6. How much are the assorted salad kits?

7. How much per pound is Lamb roast?

8. How much per pound does pork butt cost?

Shopping list:	**Price:**
1. 1 lb. Strawberries ----------	$
2. 1 lb. California Mandarins ----	$
3. 3 lbs. Chicken Breasts ---------	$
4. 1 lb. Blueberries ----------	$
5. 1lb. Grapes ----------	$
6. 1 Assorted Salad Kit ----------	$
7. 2 lbs. Pork Butt ----------	$

Budget:

$25.00

Shopping List Total:

$

Do you have enough money in your budget?

Yes ◯ No

If you *do not* have enough money, what is the least expensive thing you can remove from the shopping list to get under budget?

LIVEWORKSHEETS

Question 5

Find the missing angle of the triangle.

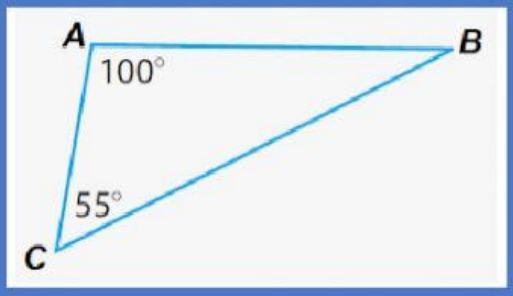

1st sum of the angles 100° + 55° = _____

2nd 180° - (sum of the angles) ° = _____

Question 6

Find the missing angle.

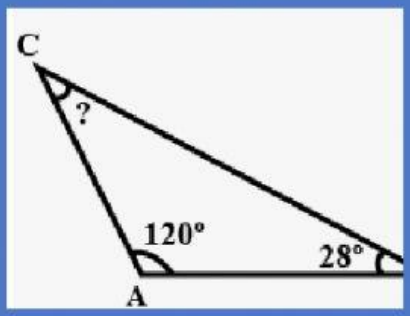

Sum of the angles = _____

Answer 180° - (Sum of the angles) = _____

LIVEWORKSHEETS