Count and Match

Count each group of objects and draw a line to the correct number.



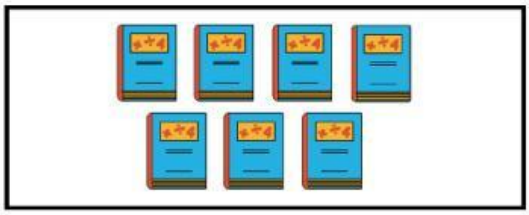



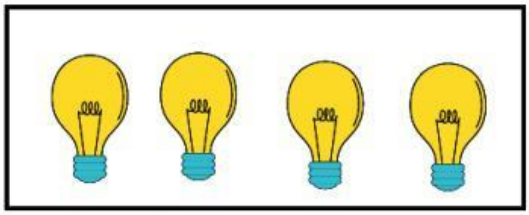







4

6

9

2

7

1

10

LIVEWORKSHEETS



Solve the problems below
Addition & Subtraction.



12 + 6 = ☐

45 + 5 = ☐

30 - 7 = ☐

40 - 25 = ☐

21 - 9 = ☐

18 + 2 = ☐





LIVEWORKSHEETS



find the missing number

9 + ☐ = 15

24 - ☐ = 16

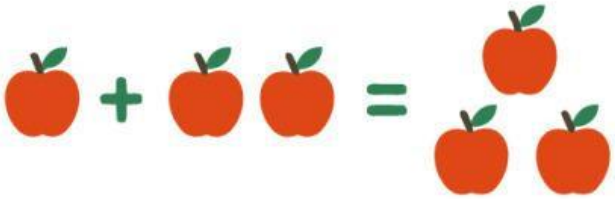

☐ +3 = 12

☐ -6 = 14

10+ ☐ = 30

☐ -10 = 30

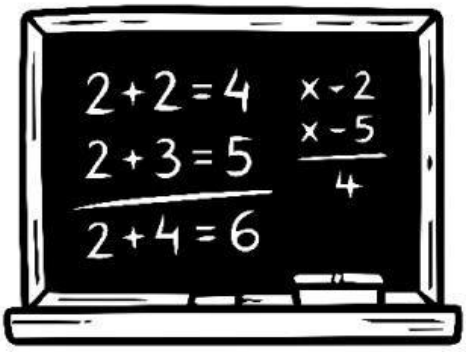



LIVEWORKSHEETS

number order from least to greatest.

35	23	12	27				

MATH

62	67	42	34				



82	96	74	63				



78	56	95	27				

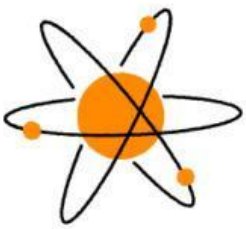

LIVEWORKSHEETS