Matematika Kelas 2 Tema 7

PECAHAN

Pecahan terdiri dari angka pembilang dan angka penyebut.

$\frac{a}{b}$

a —— pembilang

b —— penyebut

Buatlah garis antara gambar yang menunjukkan nilai pecahan pada daerah yang berwarna dengan bilangan pembilangnya!

1.

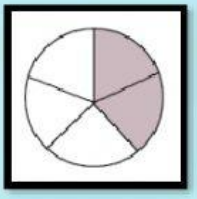

2.

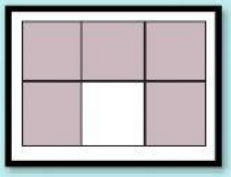

3.

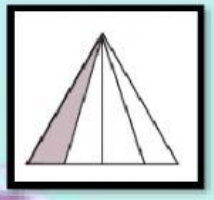

4.



5.

1 ○

2 ○

3 ○

4 ○

5 ○

LIVEWORKSHEETS

Buatlah garis antara gambar yang menunjukkan nilai pecahan dengan <u>bilangan penyebutnya</u>!

6.

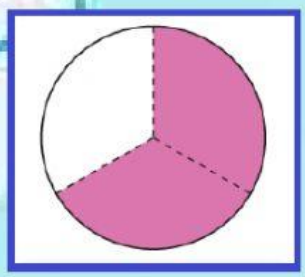

7.

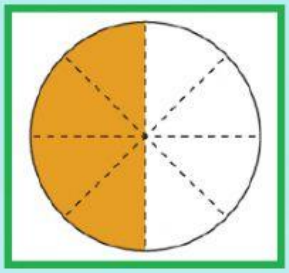

8.



9.

10.

LIVEWORKSHEETS