Harjutusleht Kolmnurga nurgad

1. Arvuta kolmnurga nurk a?

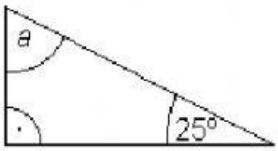

a = ° (° °) = °

2. Leia kolmnurkade puuduvad nurgad.

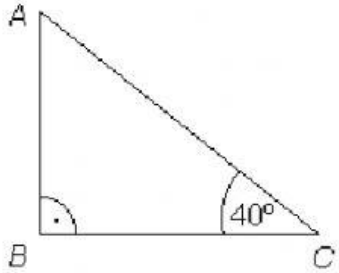

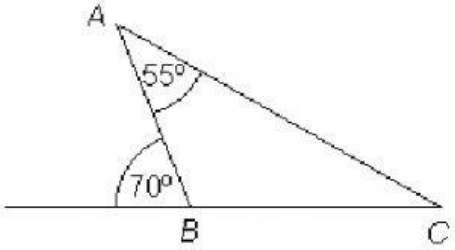

<B = °

<A = ° (° °)= °

<B = ° ° = °

<C = ° (° °)= °

3. Leia kolmnurga kolmas nurk

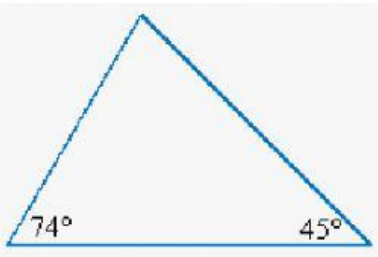

° (° °) = °

LIVEWORKSHEETS