Nama

Kelas

Ayo tentukan banyak simetri lipat yang dimiliki oleh bangun datar berikut

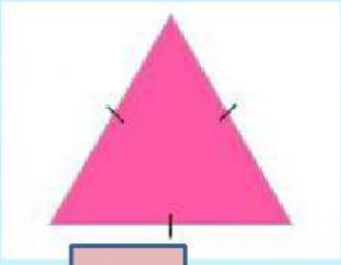



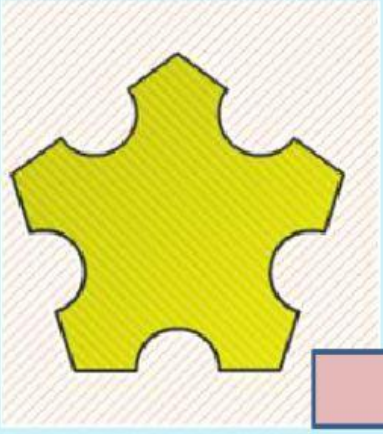







LIVEWORKSHEETS