1. Labelkan bahagian-bahagian bulatan berpusat O pada rajah di bawah.

**1.**

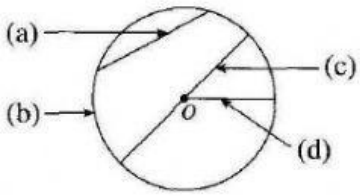


(a) .....

(b) .....

(c) .....

(d) .....

**2.**

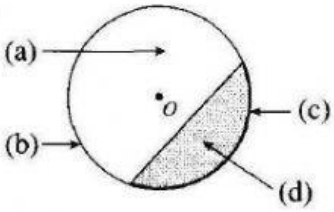


(a) .....

(b) .....

(c) .....

(d) .....

**3.**

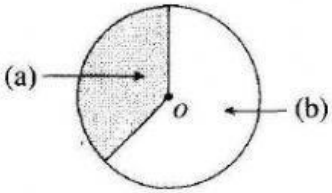


(a) .....

(b) .....

**4.**

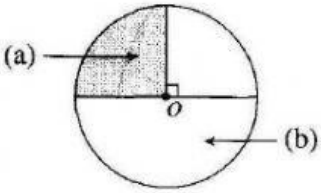


(a) .....

(b) .....

| |
|---|
| Diameter |
| Jejari |
| Lengkok major |
| Lengkok minor |
| Lilitan |
| Perentas |
| Sektor major |
| Sektor minor |
| Semibulatan |
| Sukuan bulatan |
| Tembereng major |
| Tembereng minor |

2. Berdasarkan bulatan di bawah, namakan bahagian bulatan yang berikut.

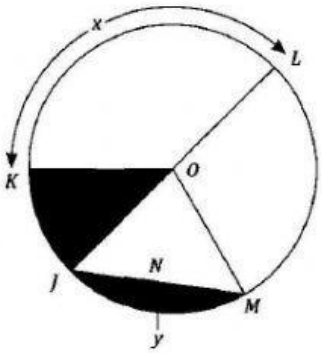


| | |
|---|---|
| (a) *JOL* | |
| (b) *OL* | |
| (c) *JNM* | |
| (d) *OJK* | |
| (e) *x* | |
| (f) *y* | |
| (g) *JKLMJ* | |

LIVEWORKSHEETS
LIVEWORKSHEETS