DIVISION

Name:_____ Class:_____ Date:_____

Look at the pictures. Complete the number sentences.

Example



8 ÷ 2 = 4

1.



6 ÷ 2 = ☐

2.

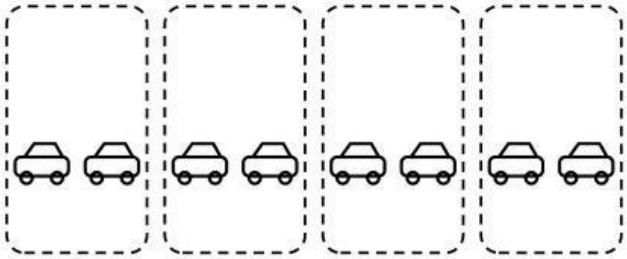

8 ÷ 4 = ☐

3.



9 ÷ 3 = ☐

4.

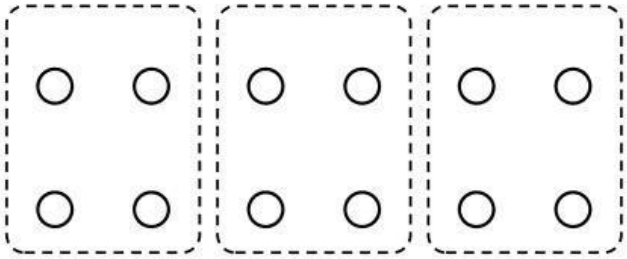

12 ÷ 3 = ☐

LIVEWORKSHEETS

DIVISION

Name:_____ Class:_____ Date:_____

Look at the pictures. Complete the number sentences.

5.

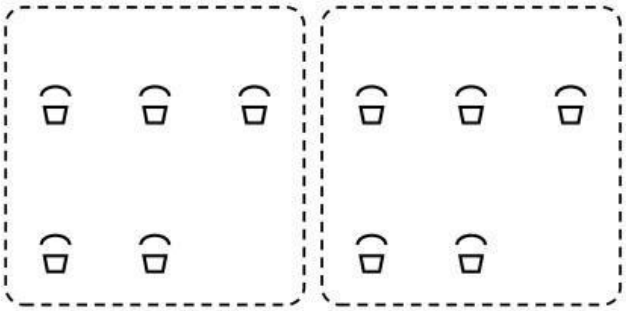

10 ÷ 2 = ☐

6.

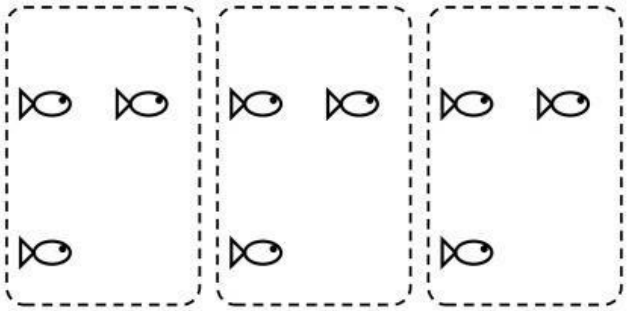

9 ÷ 3 = ☐

7.



16 ÷ 4 = ☐

8.



10 ÷ 5 = ☐

9.

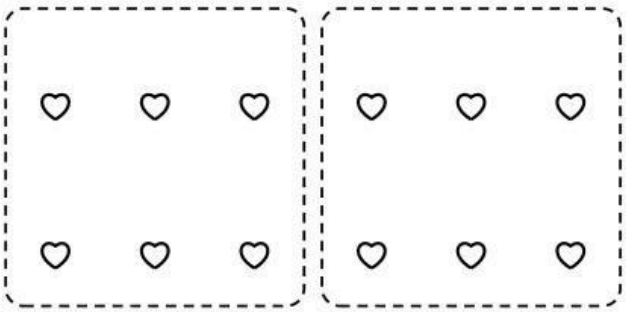

12 ÷ 2 = ☐

10.

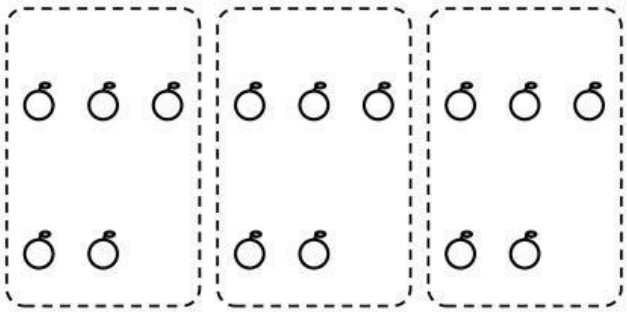

15 ÷ 3 = ☐

LIVEWORKSHEETS