DIVISION

Name : _____ Class : _____ Date : _____

Instructions: Complete the number sentences.

Example

8 ÷ 2 = 4

TOTAL ITEMS | NUMBER OF GROUPS | ITEMS IN EACH GROUP

1.



6 ÷ 2 = ☐

2.



10 ÷ 2 = ☐

3.

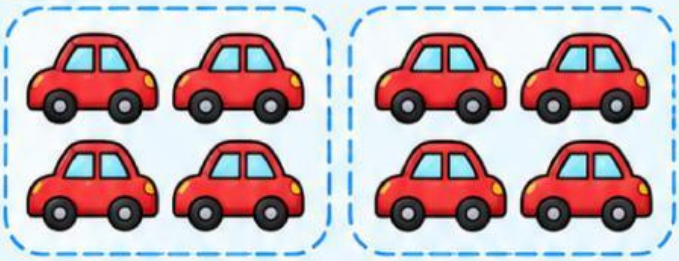

8 ÷ 2 = ☐

4.



12 ÷ 2 = ☐

LIVEWORKSHEETS

DIVISION

Name : _____ Class : _____ Date : _____

Instructions: Complete the number sentences.

5.



4 ÷ 2 = ☐

6.

9 ÷ 3 = ☐

7.



12 ÷ 3 = ☐

8.

15 ÷ 3 = ☐

9.



10 ÷ 5 = ☐

10.



16 ÷ 4 = ☐

LIVEWORKSHEETS