ICM INSAN CENDEKIA MADANI	Chapter 9 (Multiplication and Division)	Name :			
		Grade :	IV (Four)		
		Subject :	Mathematics		
		Date :			
Sequence of Teaching		Marks	Score	Teacher Signature	Parent Signature
☐ Independent Practice ✓ Assessment					

Answer the questions carefully!

1. Choose a colour and colour each chicken differently.

   Multiply the number in each chicken by 10 or 100.

   Then, colour the eggs with the correct answers matching the colour of the chicken.



[2]

2. Complete the table

	Multiply by 10	Multiply by 100
27	270	
843		84 300
560		

[2]

LIVEWORKSHEETS

3. K Match the numbers that multiply to the answers.

An example has been done for you.

5	8	45
6	7	49
7	6	48
8	5	32
9	4	30

[2]

4. A storekeeper bought 45 cartons of canned drinks. Each carton has 100 cans.

He repacked the cans into packs of 10. How many packs are there?

_____

[1]

5. Find the answer using the appropriate multiplication facts given.

13 × 6 = 78	2 × 15 = 30

a. 26 x 6 = _____

b. 8 x 15 = _____

c. 6 x 15 = _____

d. 130 x 6 = _____

[2]

6. A movie ticket cost $8.

A total of $96 was collected from the sale of the tickets for the movie.

How many people watched the movie?

_____

[1]

LIVEWORKSHEETS

7. Use the clues to complete the cross-number puzzle.

Cross

(C) 2640 ÷ 20

(E) 700 ÷ 100

Down

(A) 910 ÷ 10

(B) 7200 ÷ 600

(D) 7400 ÷ 200

Diagonal

(F) 2600 ÷ 100

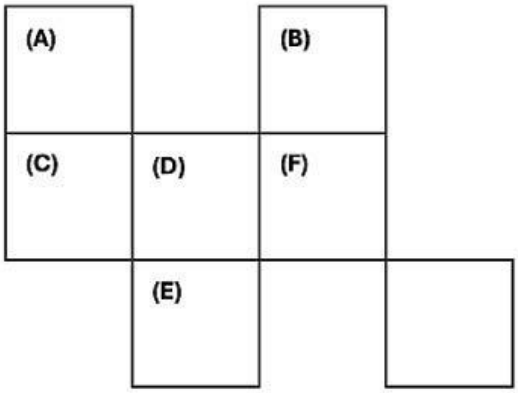

[2]

8. 79 pencils are divided into 6 stands equally.

How many pencils are there in each stand?

How many pencils are left?

_____

_____

[2]

9. Divide the number in each rabbit by 10 or 100.

Then, join each rabbit to the carrots containing the correct answers using a line.

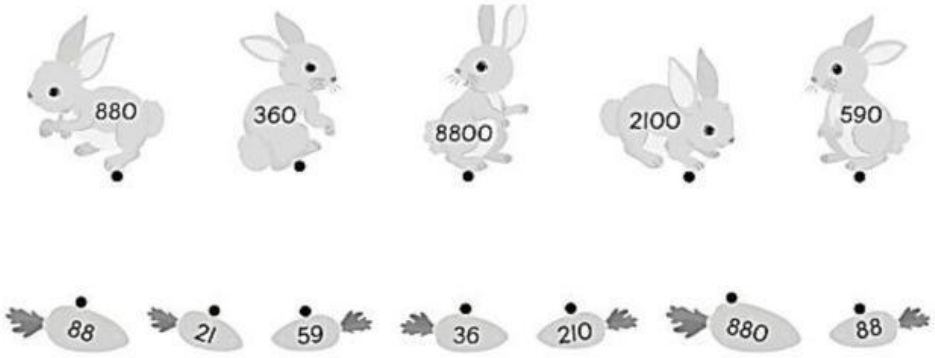

[2]

LIVEWORKSHEETS

10. There are 87 rulers.

7 rulers are packed into each bag.

How many bags of rulers are there?

How many rulers are left?

_____

_____

[2]

11. Connect the expressions with the same answer.

$7 \times 4 \times 5$ •	• 8×18
$8 \times 3 \times 6$ •	• 7×20
$9 \times 5 \times 8$ •	• 9×40

[2]

12. Safia puts 62 photos in photo frames.

Each photo frame holds 8 photos.

Write the number of photo frames she could completely fill.

_____photo frames [1]

Teacher Feedback	Parent Comment

LIVEWORKSHEETS