UNIT 6 HEAT (EXPANSION AND CONTRACTION OF MATERIALS)

material that gains heat will	material that loses heat will
_____	_____

EXAMPLE



1. put _____ into the glasses
2. glasses will _____ because the _____ heat
3. overlapping glasses can be separated

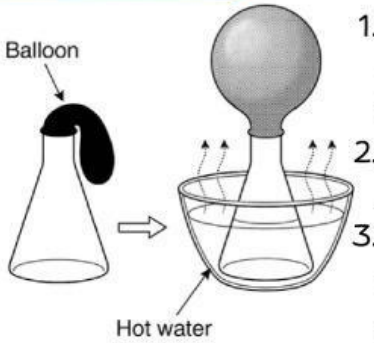

1. balloon attached to the clonical flask put into the hot water
2. balloon will _____
3. this happen because air in the balloon is _____

1. Rajah 1 menunjukkan sebiji bebola besi dipanaskan.
Diagram 1 shows a metal ball being heated.

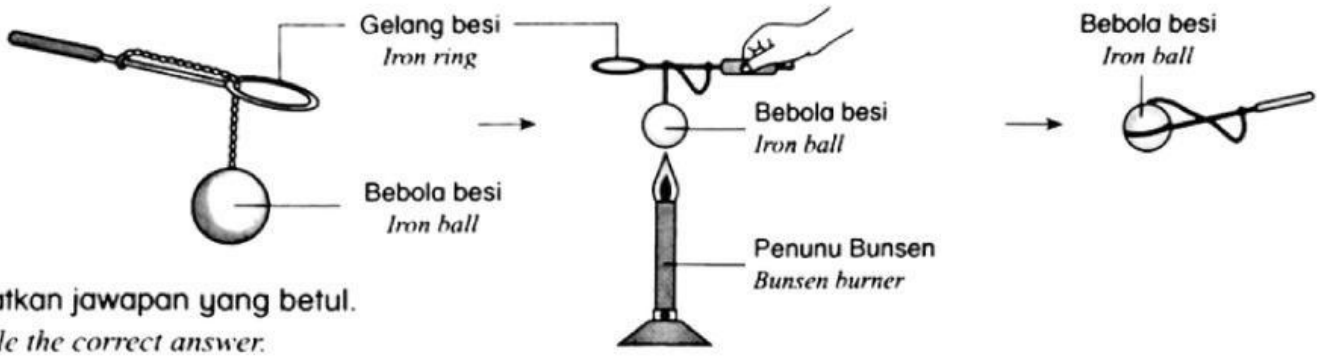

Bulatkan jawapan yang betul.
Circle the correct answer.

BEFORE THE IRON BALL IS HEATED	WHILE THE IRON BALL IS HEATED	AFTER THE IRON BALL IS HEATED
The iron ball can pass through the iron ring	The iron ball gains heat	The iron ball can pass through the iron ring
The iron ball cannot pass through the iron ring	The iron ball loses heat	The iron ball cannot pass through the iron ring

LIVEWORKSHEETS