GLI ANGOLI

Determina se l'angolo mostrato è acuto, ottuso, retto, o piatto.

Es)

1)

2)

3)

4)

5)

6)

7)

8)

9)

10)

11)

12)

13)

14)

15)

16)

17)

18)

19)

20) 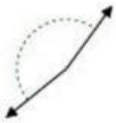

Risposte

Es. acuto

1. _____
2. _____
3. _____
4. _____
5. _____
6. _____
7. _____
8. _____
9. _____
10. _____
11. _____
12. _____
13. _____
14. _____
15. _____
16. _____
17. _____
18. _____
19. _____
20. _____

LIVEWORKSHEETS

Determina se ogni angolo descritto è 'acuto', 'ottuso', 'retto' o 'piatto'.

1) 158°

2) 180°

3) 41°

4) 15°

5) 162°

6) 122°

7) 88°

8) 45°

9) 139°

10) 23°

11) 24°

12) 85°

13) 180°

14) 110°

15) 90°

16) 129°

17) 157°

18) 7°

19) 98°

20) 2°

Risposte

1. _____
2. _____
3. _____
4. _____
5. _____
6. _____
7. _____
8. _____
9. _____
10. _____
11. _____
12. _____
13. _____
14. _____
15. _____
16. _____
17. _____
18. _____
19. _____
20. _____

LIVEWORKSHEETS

Usa il goniometro per determinare ogni angolo.

1)

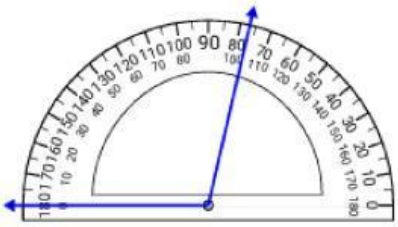

2)

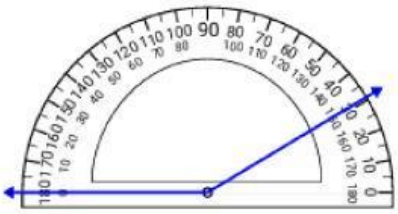

3)

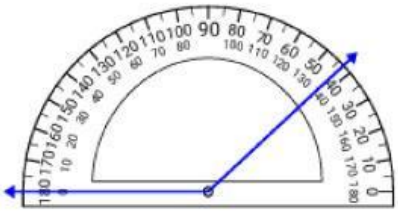

4)

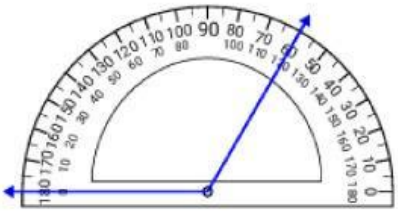

5)

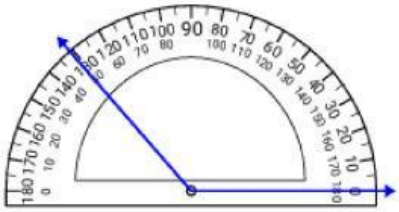

6)

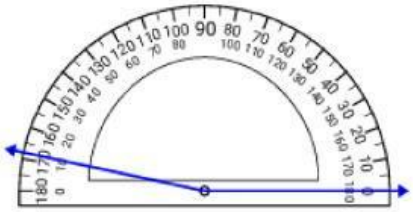

7)

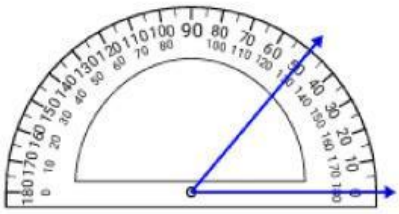

8)

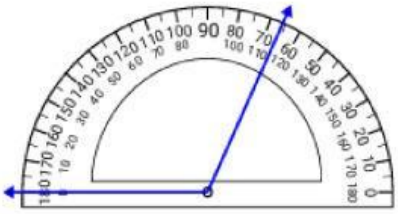

9)

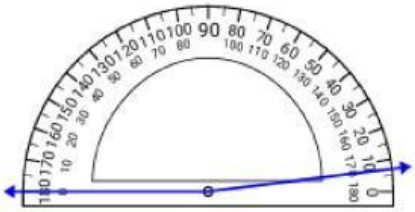

10)

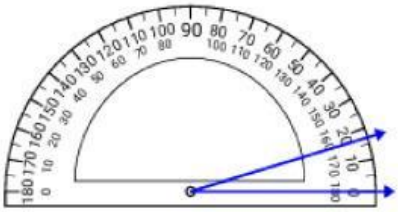

Risposte

1. _____
2. _____
3. _____
4. _____
5. _____
6. _____
7. _____
8. _____
9. _____
10. _____

LIVEWORKSHEETS