# MATHEMATICS EXERCISE: AREA

Name: _____ Date: _____

- Area of a rectangle = length × width
- Total area = Area of shape 1 + Area of shape 2
- Answer unit: $cm^2$

**Find the area of each given shape. Show the calculation and write the answer in $cm^2$.**

**1**

Find the area of the given shape.

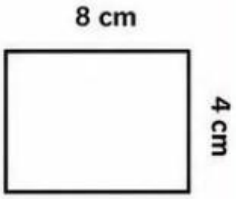


Answer: _____

**2**

Find the area of the given shape.

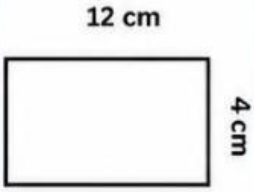


Answer: _____

**3**

Find the area of the given shape.

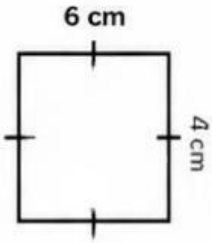


Answer: _____

**4**

Find the area of the given shape.

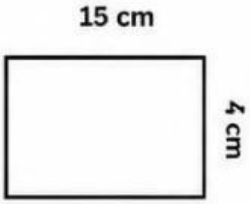


Answer: _____

**5**

Find the area of the given shape.

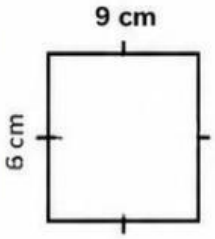


Answer: _____

**6**

Find the area of the given shape.

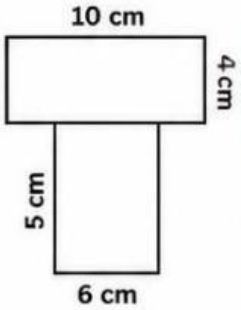


Answer: _____

**7**

Find the area of the given shape.

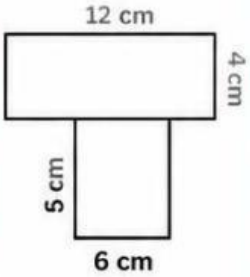


Answer: _____

**8**

Find the area of the given shape.

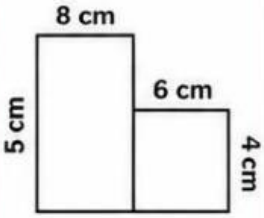


Answer: _____

**9**

Find the area of the given shape.

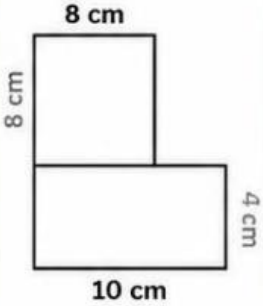


Answer: _____

**10**

Find the area of the given shape.

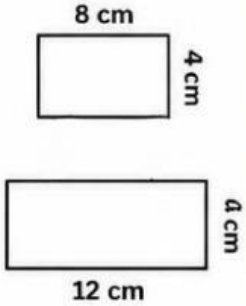


Answer: _____

**Effort + Focus = Success!**

LIVEWORKSHEETS