Name: Date:

AREA OF SHAPES

Calculate the area of the following shapes:

Area = _____ cm^2

Area = _____ cm^2

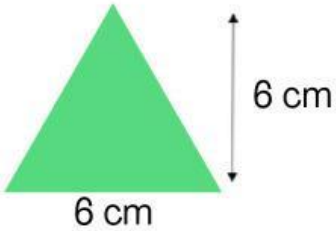

Area = _____ cm^2

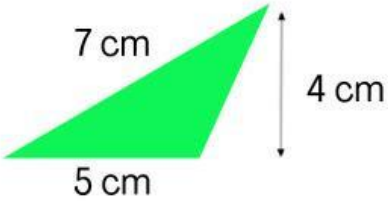

Area = _____ cm^2

Area = _____ cm^2

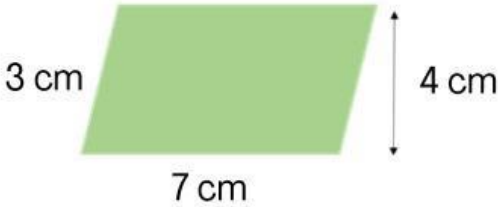

Area = _____ cm^2

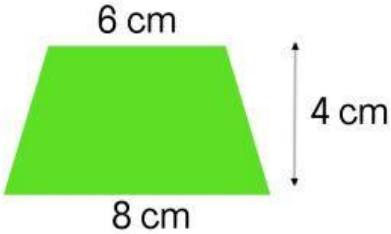

Area = _____ cm^2

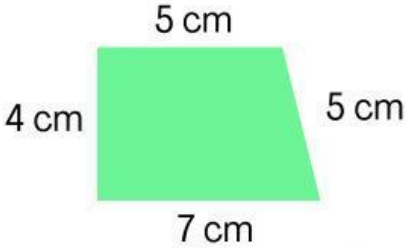

Area = _____ cm^2

LIVEWORKSHEETS