Name: Date:

AREA OF SHAPES

Calculate the area of the following shapes:

Area = _____ cm^2

Area = _____ cm^2

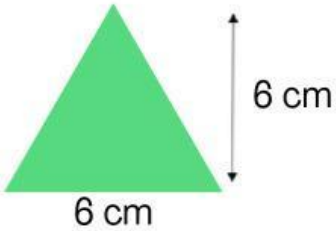

Area = _____ cm^2

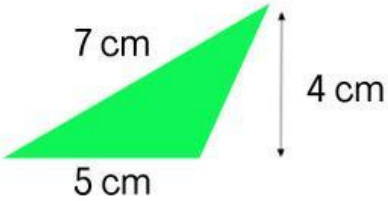

Area = _____ cm^2

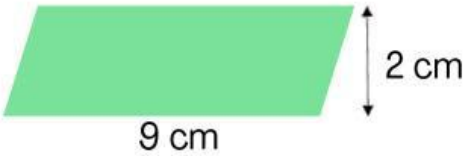

Area = _____ cm^2

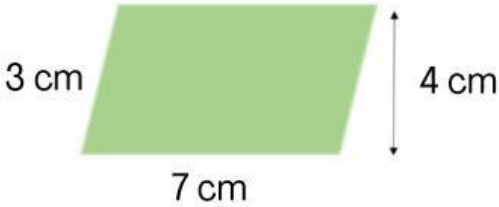

Area = _____ cm^2

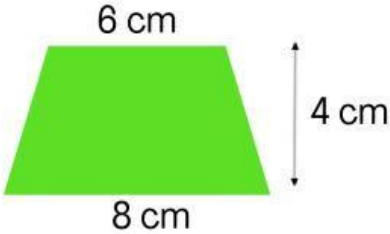

Area = _____ cm^2

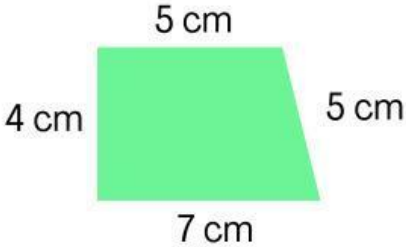

Area = _____ cm^2

LIVEWORKSHEETS

Name: Date:

Area of Circles

Area of a Circle = $\pi \times r^2$

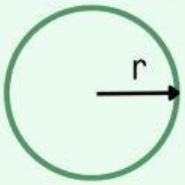

Calculate the area of the following circles :

1

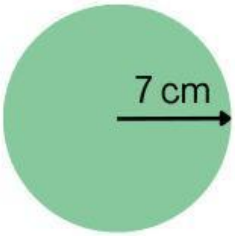

Area = _____ cm^2

2

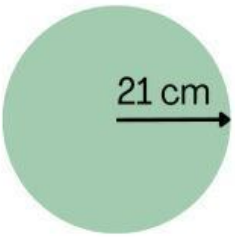

Area = _____ cm^2

3

Area = _____ mm^2

4

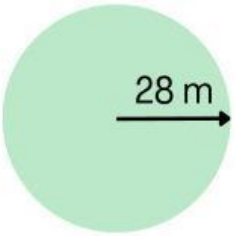

Area = _____ m^2

5

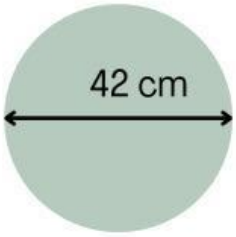

Area = _____ cm^2

6

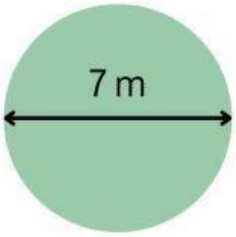

Area = _____ m^2

LIVEWORKSHEETS