2. บอกชื่อของรูปเรขาคณิตสามมิติต่อไปนี้

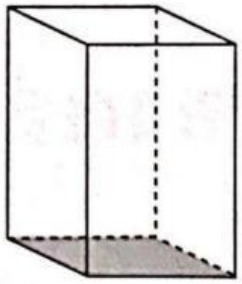

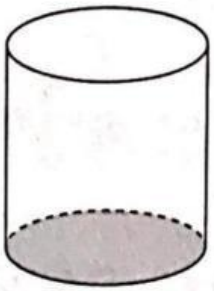

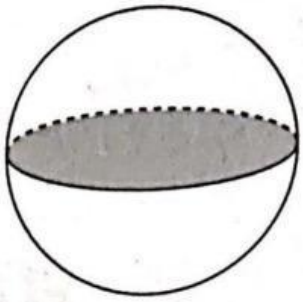

....



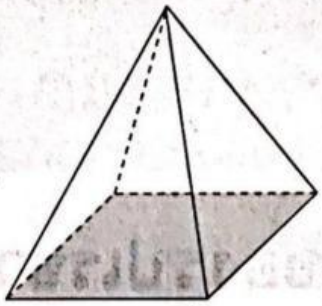

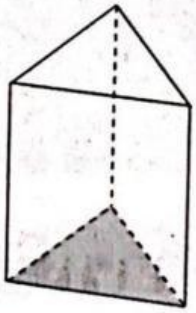

....

3. จากรูปที่กำหนดให้



ก

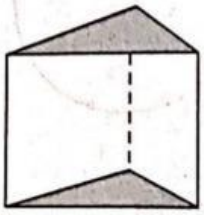

ข

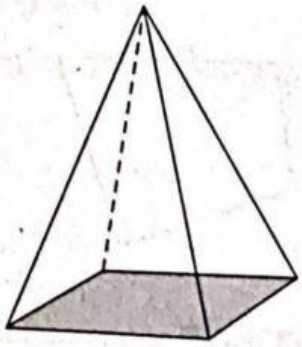

ค

รูปใดบ้างเป็นปริซึม .....

รูปใดบ้างเป็นพีระมิด .....

LIVEWORKSHEETS