Họ và tên: _____ Ngày: _____

1. Đồng hồ chỉ mấy giờ?



LIVEWORKSHEETS

2. Điền số còn thiếu

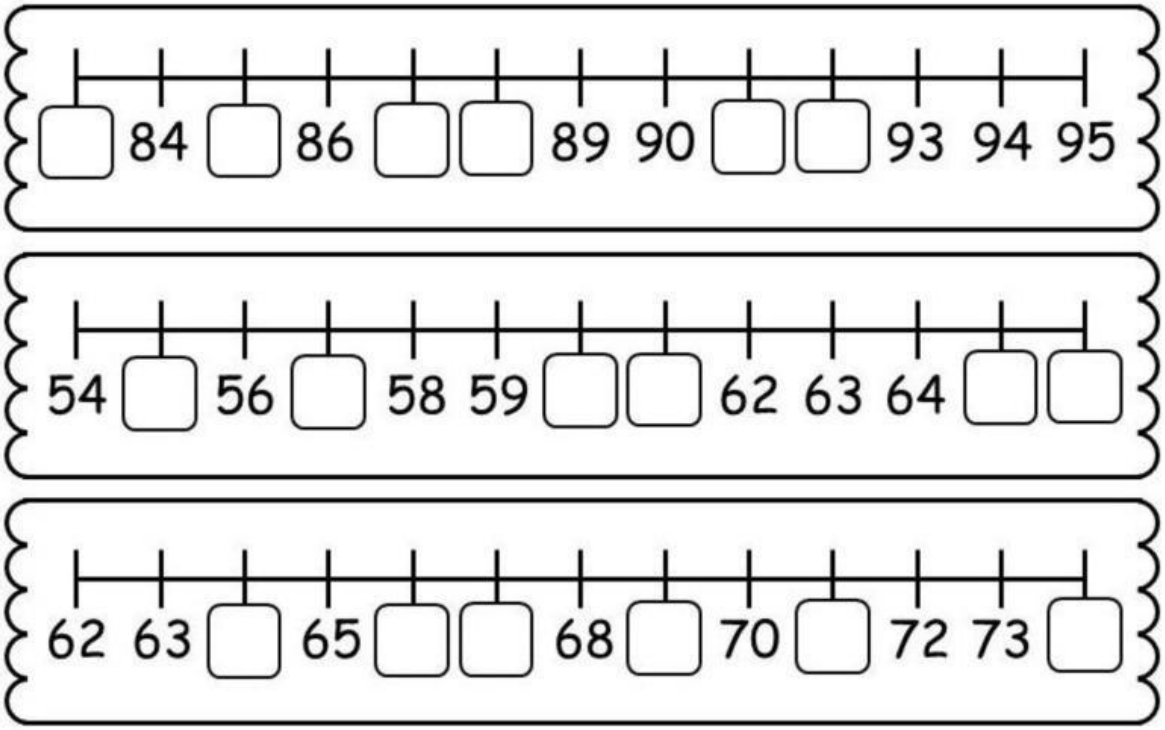

3. Đếm ngược

25			22						16
33			30				26		24
		40			37			34	
	50			47			44		42

LIVEWORKSHEETS

4. Sắp xếp sô theo thức tự từ bé đến lớn

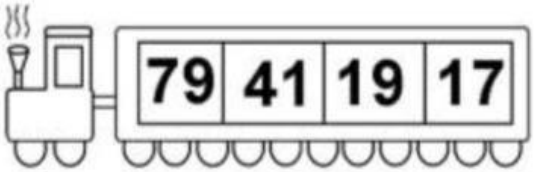

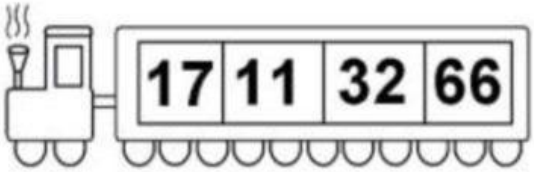

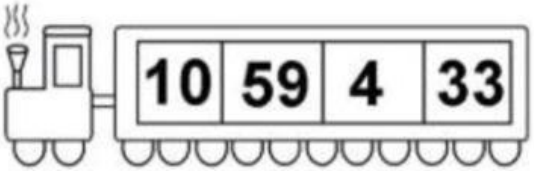

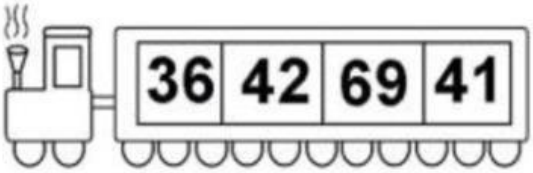

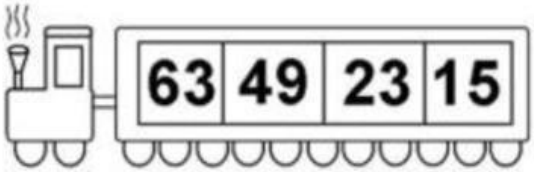

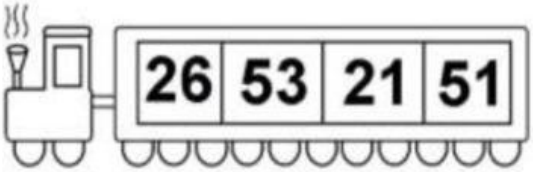

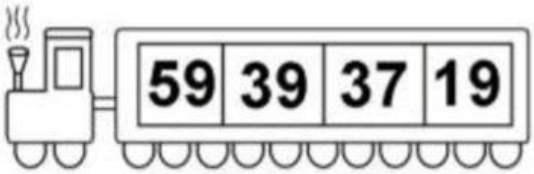

LIVEWORKSHEETS

5. Thực hiện phép tính

① 6 − 2 − 1 = ☐

② 5 − 1 − 2 = ☐

③ 4 − 1 − 1 = ☐

④ 6 − 3 − 1 = ☐

⑤ 7 − 2 − 3 = ☐

⑥ 8 − 3 − 3 = ☐

⑦ 5 − 3 − 1 = ☐

⑧ 9 − 4 − 3 = ☐

⑨ 7 − 3 − 3 = ☐

⑩ 8 − 2 − 3 = ☐

⑪ 6 − 1 − 3 = ☐

⑫ 7 − 1 − 4 = ☐

⑬ 8 − 1 − 5 = ☐

⑭ 9 − 5 − 2 = ☐

LIVEWORKSHEETS