مؤسسة الإمارات للتعليم المدرسي
EMIRATES SCHOOLS ESTABLISHMENT

CHAPTER 7 - LESSON 6 – SLOPE AND SIMILAR TRIANGLES – PAGE 559

Date: 03/23/2021 Room#: Class: 8.4

$\text{slope} = \frac{\text{rise}}{\text{run}}$	$\text{slope} = \frac{\text{change in } y}{\text{change in } x}$	$m = \frac{y_2 - y_1}{x_2 - x_1}$

Calculate the slopes of the triangles to determine if they are similar		
1	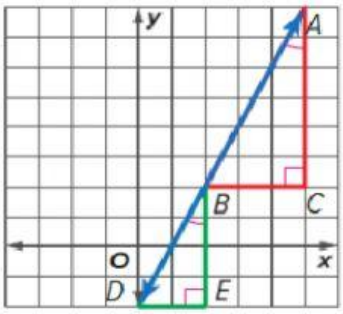	$\text{slope} = \frac{\text{rise}}{\text{run}}$ **Slope = m = — =**
2	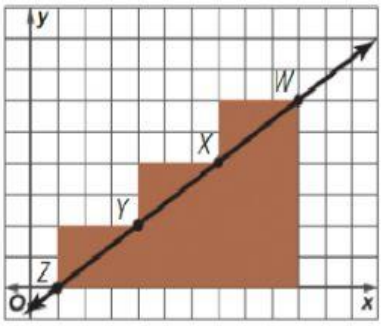	$\text{slope} = \frac{\text{rise}}{\text{run}}$ **Slope = m = — =**

LIVEWORKSHEETS

مؤسسة الإمارات للتعليم المدرسي
EMIRATES SCHOOLS ESTABLISHMENT

CHAPTER 7 - LESSON 6 – SLOPE AND SIMILAR TRIANGLES – PAGE 559

Date: 03/23/2021 Room#: Class: 8.4

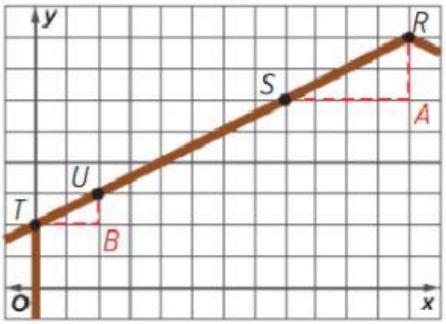

$$\text{slope} = \frac{\text{rise}}{\text{run}}$$

Slope = m = — =

Thanks a lot…

LIVEWORKSHEETS