Họ và tên: .....

Lớp : 1A...

PHIẾU TƯ DUY 6

Bài 1: Con chọn đồ vật ghi số bé hơn trong mỗi hình.

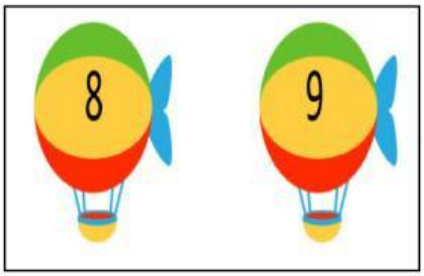

Bài 2: Con hãy điền số và dấu vào ô trống (theo mẫu).

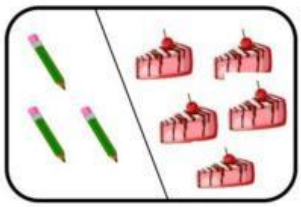

3 < 5



2 ☐ 4

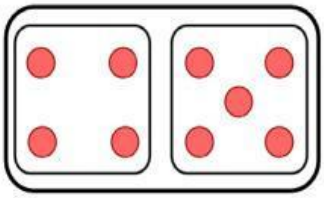

4 ☐ ☐

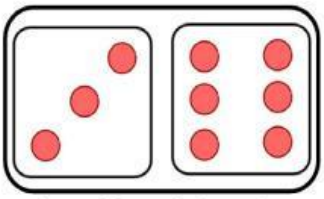

☐ ☐ 6

Bài 3: Tìm số thích hợp.



4 1



3 0



6 8

Bài 4: Con hãy điền số và dấu vào ô trống (theo mẫu).

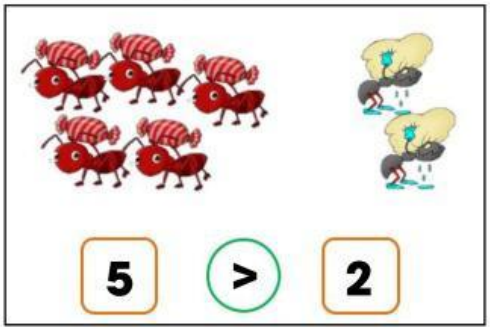

5 > 2

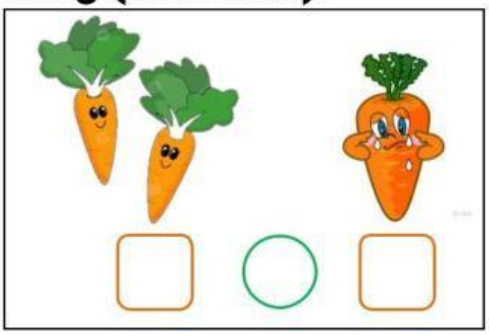

☐ ○ ☐

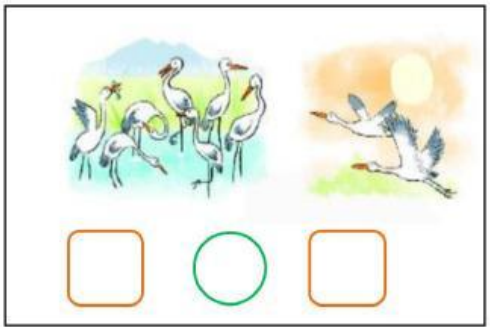

☐ ○ ☐



☐ ○ ☐

LIVEWORKSHEETS