LKPD

MATEMATIKA

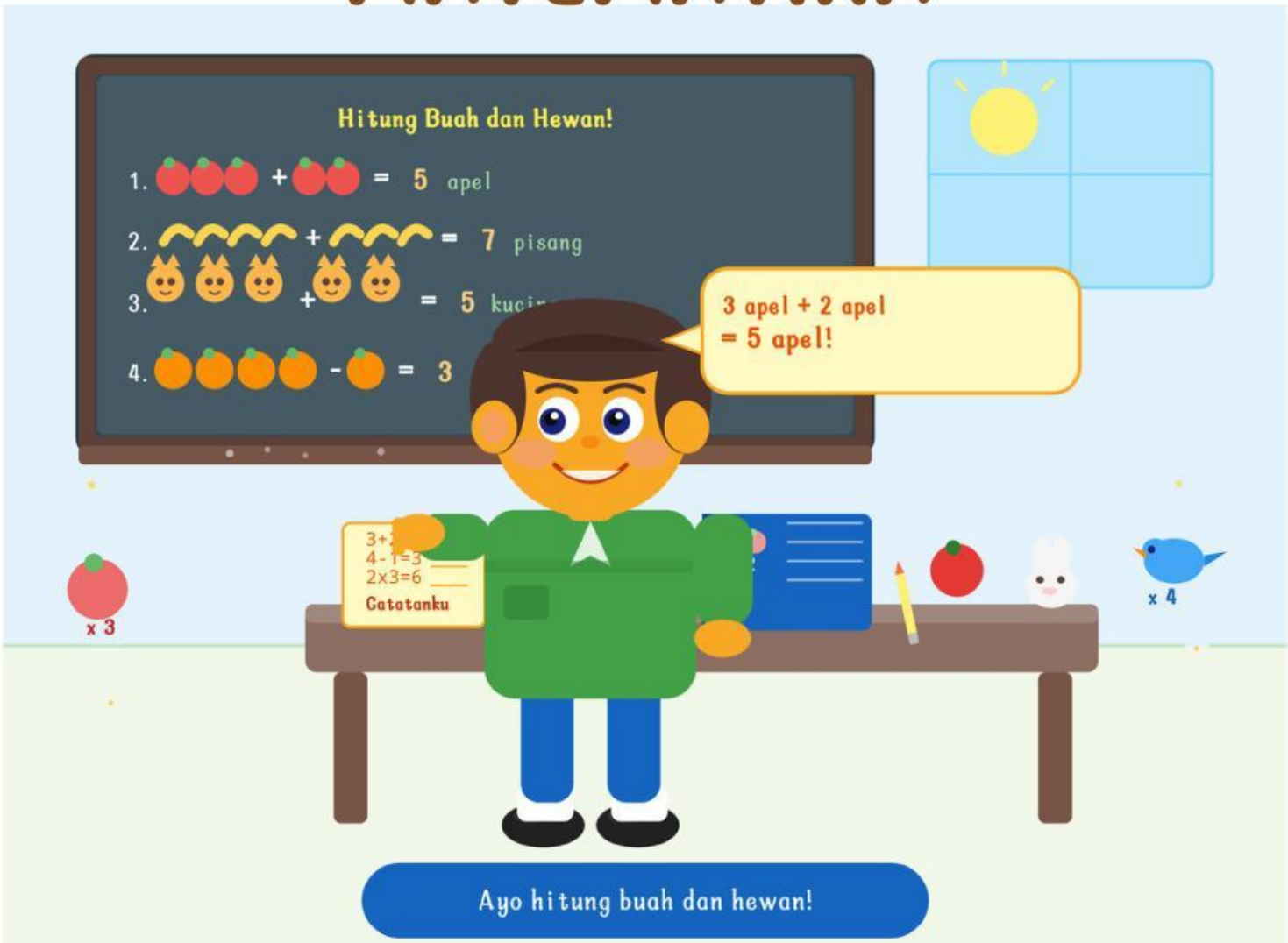

NAMA :

KELAS :

LIVEWORKSHEETS

MARi MENGHiTUNG

HiTUNGLAH JUMLAH GAMBAR BUAH DiBAWAH iNi, LALU TULiS JAWABANMU DiKOTAK YANG TELAH KAMi SEDiAKAN.









LIVEWORKSHEETS

HITUNGLAH JUMLAH HEWAN DIBAWAH INI SESUAI SPESIES MASING-MASING.



= ☐

= ☐

= ☐

LIVEWORKSHEETS

BERHiTUNG DAN MENCOCOKKAN

HiTUNGLAH GAMBAR DiBAWAH iNi LALU COCOKKAN DENGAN ANGKA YANG SESUAi DENGAN JUMLAH BENDA DiSAMPiNGNYA

• • 3

• • 5



• • 1

• • 4

• • 2



• • 6

LIVEWORKSHEETS

AYO ISI ANGKA APEL YANG HILANG DIAPEL-APEL INI SUPAYA POHONNYA PENUH KEMBALI.







LIVEWORKSHEETS

MENGHITUNG BUAH DAN HEWAN









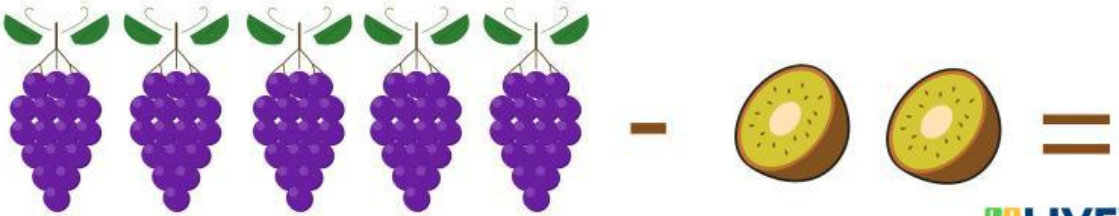

LIVEWORKSHEETS