LEMBAR KERJA PESERTA DIDIK

Mata Pelajaran : **Matematika**

Kelas : **V (Lima)**

Nama : .....

A. Tentukan Volume Kubus di bawah ini !

1.

Volume = ____ cm^3

3.

Volume = ____ cm^3

5.

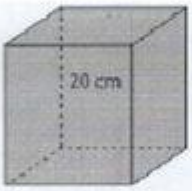

Volume = ____ cm^3

2.

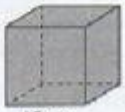

Volume = ____ cm^3

4.

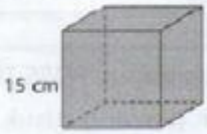

Volume = ____ cm^3

6.

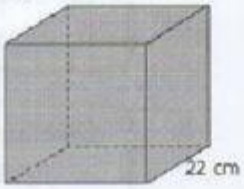

Volume = ____ cm^3

B. Tentukan Volume Balok di bawah ini!

1.

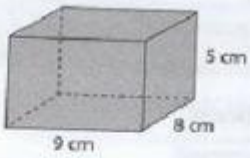

Volume = ____ cm^3

3.

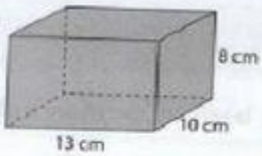

Volume = ____ cm^3

5.

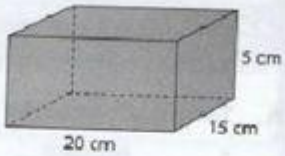

Volume = ____ cm^3

2.

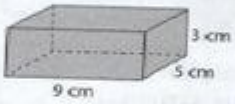

Volume = ____ cm^3

4.

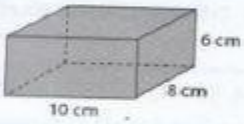

Volume = ____ cm^3

6.

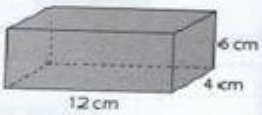

Volume = ____ cm^3

LIVEWORKSHEETS