Name: _____ **HELIX EDUCATION**

Class: _____

TEST

1- 5. Read the pictograph and answer question 1 to 5.

A group of children voted for their favorite toys.

Number of children who voted

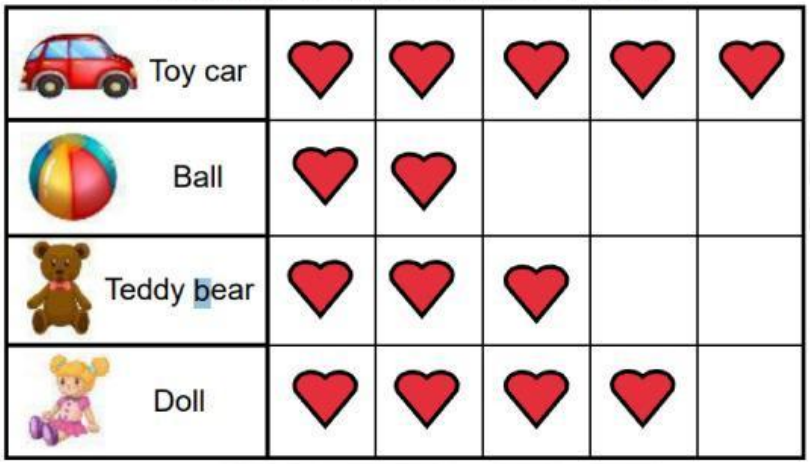

= 2 children

1. How many children voted for the doll?

Answer: _____

2. How many children voted for the teddy bear?

Answer: _____

4. What toy is liked the least by the children?

Answer: _____

3. What toy is liked the most by the children?

Answer: _____

5. How many children voted in total?

Answer: _____

6. According to the pattern shown below, what is the number in the blank?

2 、 1 、 4 、 2 、 6 、 3 、 __、 4、 10

Answer: _____

7. Arrange numbers below from the greatest to the smallest, to find the 3rd number.

17, 84, 62, 94, 20, 75, 40.

Answer: _____

LIVEWORKSHEETS

8. How many sides are there in the following figure?

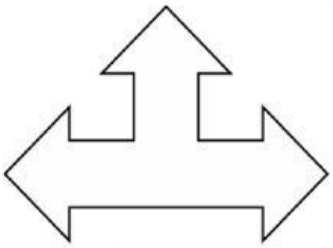

Answer: _____

9. How many triangles are there in the following figure?

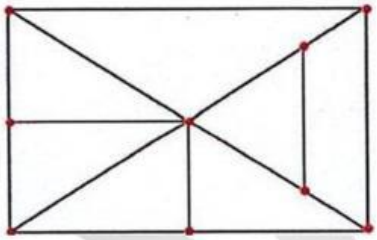

Answer: _____

10. What time will it be in 3 hours? Given that the time now is in the morning.

Answer: _____

11. The library only opens for 5 hours on Sundays. If it opens at 12 o'clock at noon, at what time does it close?

Answer: _____

12. The teacher starts a meeting on Monday at 8 o'clock in the morning. The meeting ends at 1 o'clock in the afternoon. How long is the meeting?

Answer: _____

13. If tomorrow will be Thursday, which day of the week will 8 days later be?

Answer: _____

14. On Monday, Tracy starts to paint the word HELIXEDUCATION. Each day he paints one letter. On what day will he paint the last letter?

Answer: _____

HELIX EDUCATION
KHUYẾN CÁM MÊ - TRAO NHIỆT HUYẾT
LIVEWORKSHEETS

15. How many days are there in May?

Answer: _____

16. 5 years ago, Amy was 12 years old. How old will Amy be 4 years later?

Answer: _____

17. After 6 years, Amy will be 13 years old. How old was Amy 4 years ago?

Answer: _____

18. Find a number such that when I add this number to 15, then subtract 25, the result is 30. What number is this?

Answer: _____

19. Emma has three rulers: a white ruler is 15 cm long, a yellow ruler is 25 cm long and a brown ruler is 10 cm long. Which ruler is the shortest?

Answer: _____

20. Channy chooses 2 different digits from 2, 4, and 9 to form 2-digit numbers. Among those numbers, how many even numbers are there?

Answer: _____

21. Lucy chooses 2 different digits from 1, 3, 4, 5, and 8 to form a 2-digit number. What is the smallest odd number can Lucy form?

Answer: _____

22. Class 1T has 24 students queuing up in a row. If there are 10 students behind Amy, how many students are in front of Amy?

Answer: _____

23. How many cubes are there in the following figure?

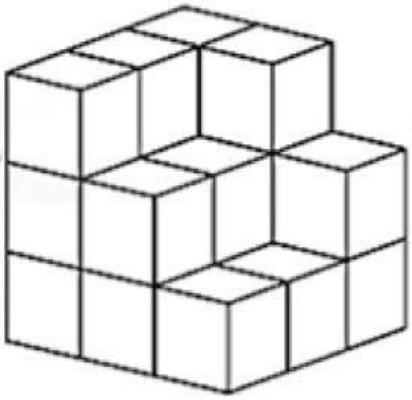

Answer: _____

LIVEWORKSHEETS

24. In the magic square, the sum of the three numbers in each row, column and diagonal is 15. Find X

	9	4
7		
	1	X

Answer: _____

25. Lucas has 2 one-dollar bills, 3 dimes and 3 nickels. How much money does Lucas have?

Answer: _____

HELIX EDUCATION
TRUYỀN ĐAM MÊ - TRAO NHIỆT HUYẾT

LIVEWORKSHEETS