TIPOS DE ÁNGULOS

Nombre: _____

Grado: _____

ASSESSMENT 4to

Parea e identifica cada ángulo.

1

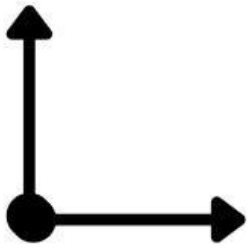

agudo

2

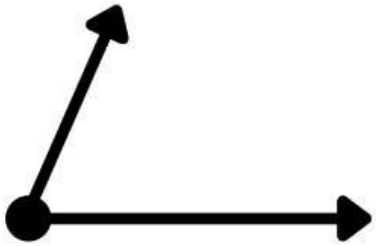

obtuso

3

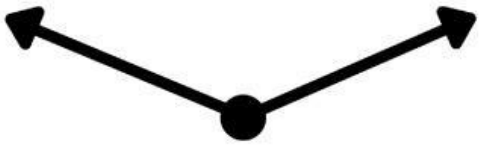

recto

4

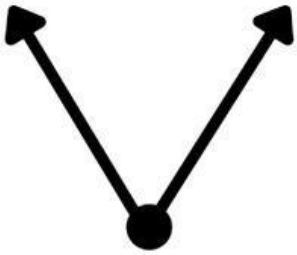

LIVEWORKSHEETS