Name: _____ Class_____ Date: _____

1. Find the missing sides of the triangles below.

a

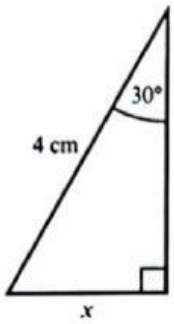

b

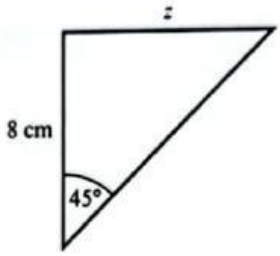

c

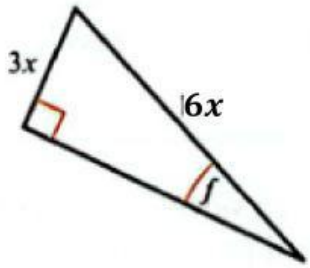

LIVEWORKSHEETS

2. **Find the area of the triangle ACD.**

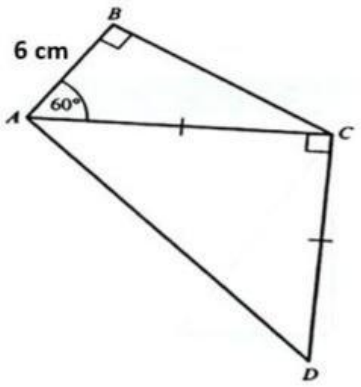

LIVEWORKSHEETS