LATIHAN 1
JENIS-JENIS SUDUT

Berburu Sudut di Rumah Banjar!

Ayo cari sudut di rumah Banjar!
Amati gambar sudut di kiri, lalu hubungkan dengan bagian rumah Banjar di tengah dan nama sudut di kanan yang sesuai!

Nama: _____

Kelas: _____

Ingat!
Sudut adalah bukaan yang terbentuk dari dua garis yang bertemu pada satu titik.

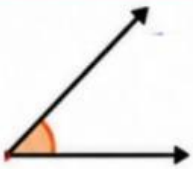

Sudut Tumpul

Sudut Lancip

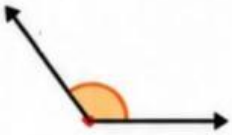

Sudut Siku-siku

Sudut Refleks

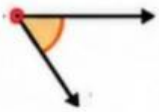

Sudut Lurus

Hebat! Kamu sudah belajar mengenali sudut di rumah Banjar.
Terus semangat belajar dan amati sudut di sekitarmu!

LIVEWORKSHEETS

LATIHAN 2
SUDUT DAN BESARNYA

Nama: _____

Kelas: _____

Amatilah gambar sudut di bawah ini. Tuliskan nama jenis sudut berdasarkan besar sudutnya dengan tepat!

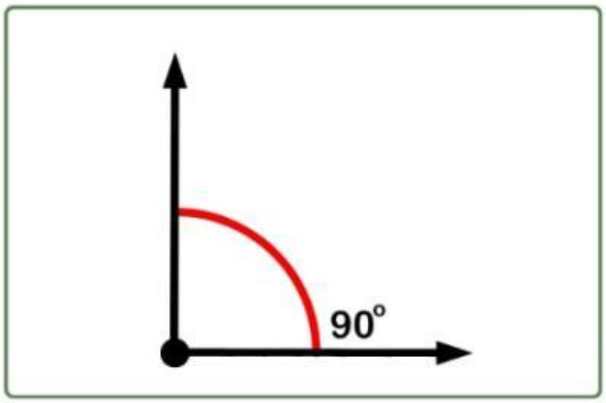

Sudut siku-siku

.....

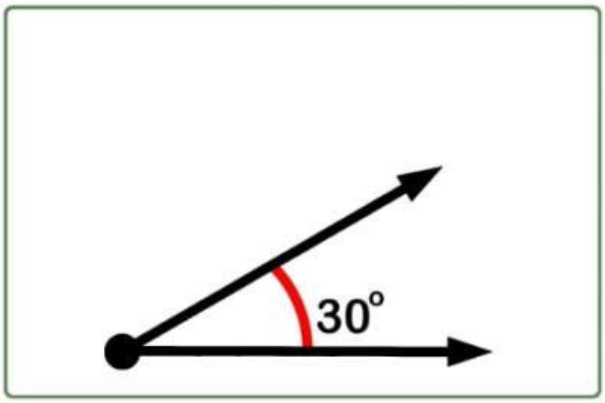

.....

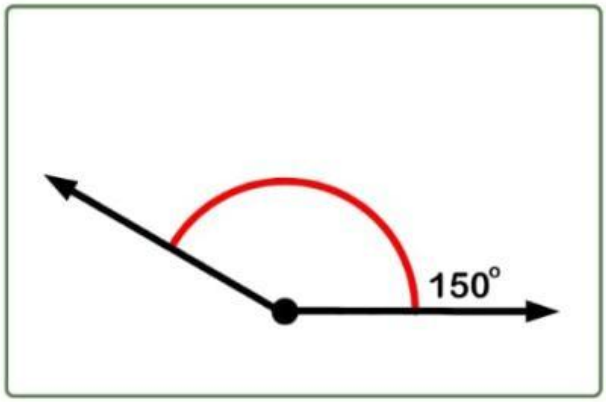

.....

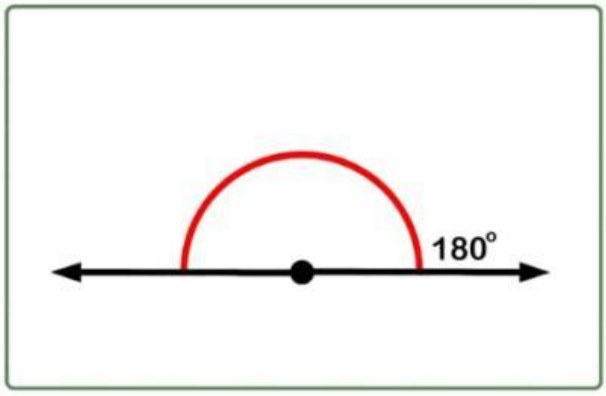

.....

LIVEWORKSHEETS

LATIHAN 3
MENGUKUR SUDUT MENGGUNAKAN BUSUR DERAJAT

Nama: _____

Kelas: _____

Nyatakan ukuran sudut yang ditunjukkan dengan menggunakan busur derajat.

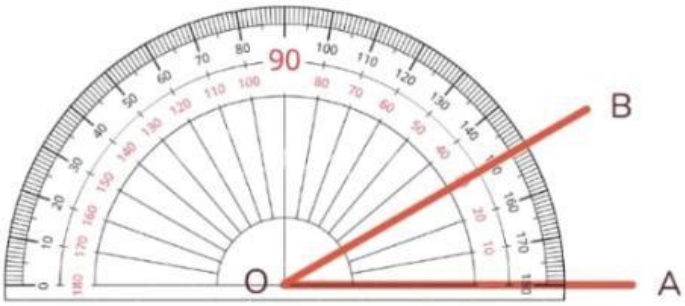

∠AOB = ...

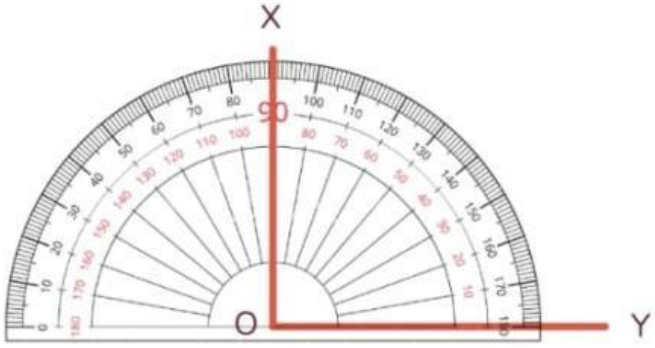

∠XOY = ...

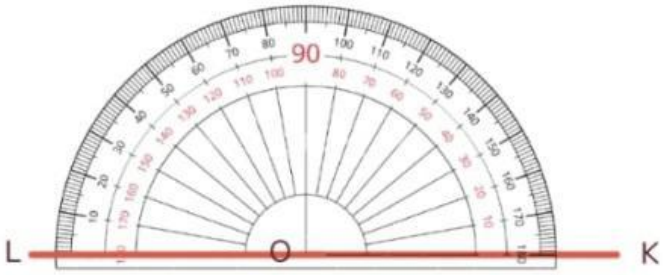

∠KOL = ...

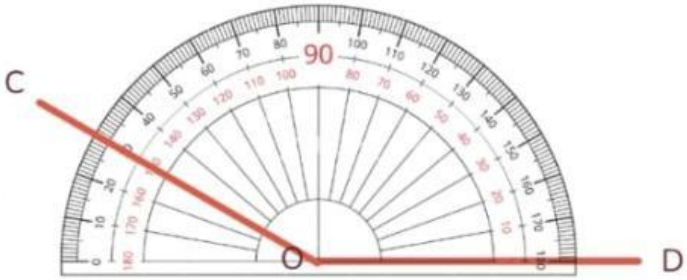

∠COD = ...

LIVEWORKSHEETS