Ayo Berlatih!

1. Bandingkan banyak benda di bawah ini!

A



B

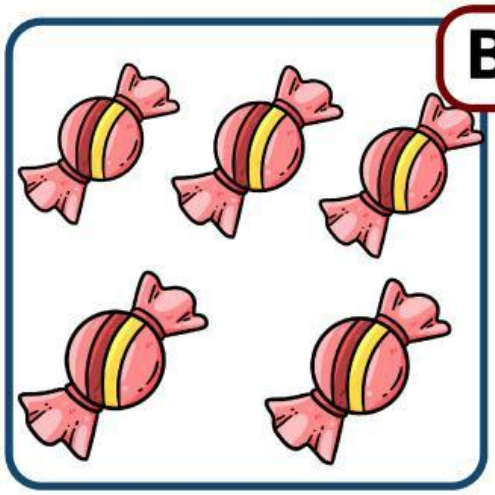

Benda mana yang jumlahnya lebih banyak?.....

Benda mana yang jumlahnya lebih sedikit?.....

2. Bola mana yang jumlahnya lebih banyak?



a



b

3. Semangka mana yang jumlahnya lebih sedikit?



a



b

LIVEWORKSHEETS