Name : _____

Perimeter

Sheet 1

Find the perimeter of each shape.

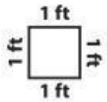

1)



Perimeter = _____ ft

2)

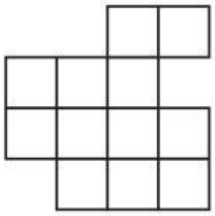

Perimeter = _____ ft

3)

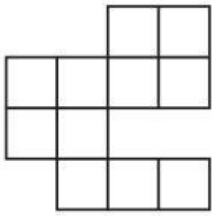

Perimeter = _____ ft

4)



Perimeter = _____ ft

5)

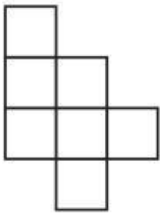

Perimeter = _____ ft

6)

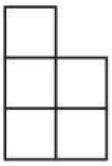

Perimeter = _____ ft

7)

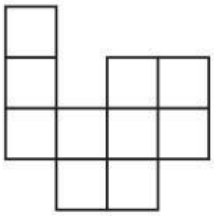

Perimeter = _____ ft

8)

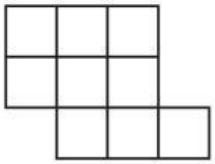

Perimeter = _____ ft

9)



Perimeter = _____ ft

10)

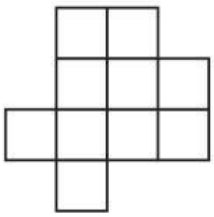

Perimeter = _____ ft

11)



Perimeter = _____ ft

12)

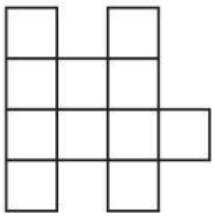

Perimeter = _____ ft

LIVEWORKSHEETS