LATIHAN 1
JENIS-JENIS SUDUT

Nama: _____

Kelas: _____

Amati sudut berikut. Hubungkan gambar sudut dengan nama sudut yang sesuai!

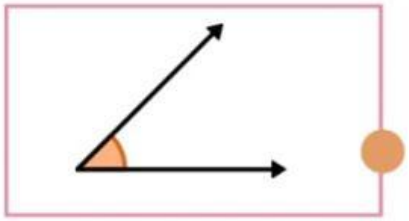

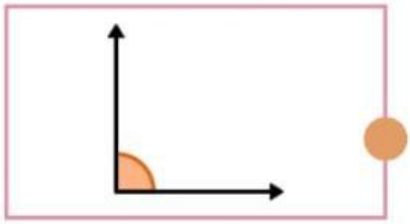

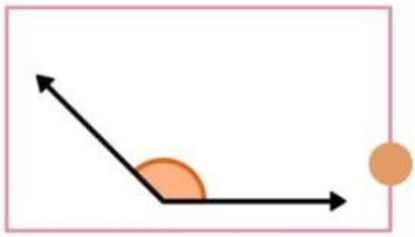

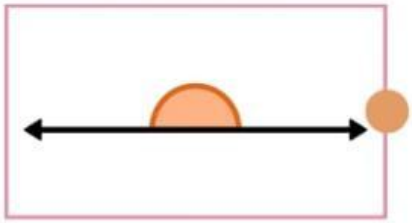

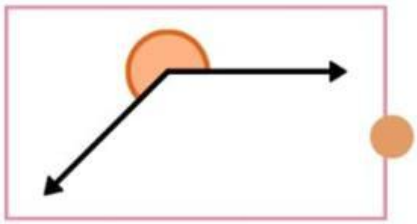

- Sudut Tumpul
- Sudut Lancip
- Sudut Siku-siku
- Sudut Refleks
- Sudut Lurus

LIVEWORKSHEETS