LEMBAR KERJA PESERTA DIDIK

LKPD

MATEMATIKA



NAMA :

KELAS :

LIVEWORKSHEETS

Amati teka teki yang tersedia lalu isi kolom yang kosong dengan jawaban yang tepat

2	x	...	=	8	x	...	=	16						
		x				x								
		3				2	x	7	=	...				
		=				=				x				
		...		3	x	...	=	12		2				
				x						=				
				...	x	2	=	...		...				
				=				x						
		2	x	9	=	...		1						
		x						=						
...		...				...	x	6	=	12				
x		=				x								
5	x	4	=	...		...	x	9	=	...				
=						=								
10						4	x	4	=	16				

LIVEWORKSHEETS

Penjumlahan Domino

Hitunglah jumlah domino berikut.

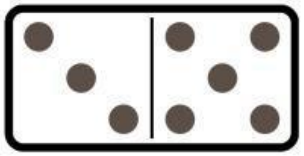

3 + 5 = 8



4 + 4 = ____

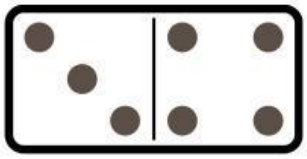

3 + 4 = ____

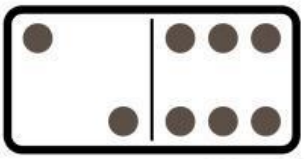

2 + 6 = ____



5 + 3 = ____

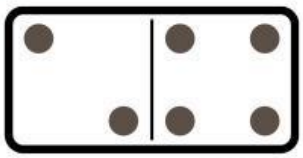

2 + 4 = ____

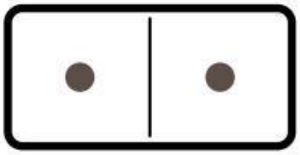

1 + 1 = ____



6 + 6 = ____



1 + 6 = ____

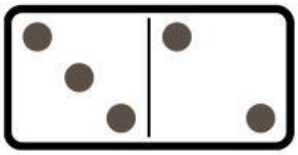

3 + 2 = ____



5 + 5 = ____

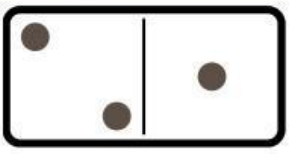

2 + 1 = ____



6 + 3 = ____

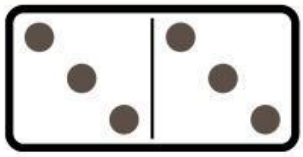

3 + 3 = ____

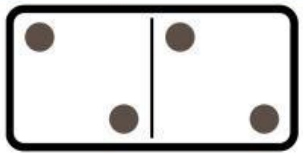

2 + 2 = ____

LIVEWORKSHEETS

PENJUMLAHAN

Ayo menghitung buah – buahan berikut !

LIVEWORKSHEETS

MEMASANGKAN PECAHAN

Pasangkan gambar pecahan berikut dengan angka yang benar.

$\frac{1}{2}$

$\frac{2}{9}$

$\frac{1}{4}$

$\frac{4}{6}$

$\frac{3}{8}$

$\frac{1}{6}$

LIVEWORKSHEETS

SOAL LATIHAN OPERASI HITUNG DASAR

PETUNJUK : Hubungkan setiap soal operasi hitung dasar dengan jawaban yang benar!

$5 + 3$	12	$15 - 9$
	4	
$12 - 5$	8	3×5
	2	
6×2	7	$20 \div 5$
	11	
$16 \div 4$	6	$8 + 6$
	15	
$9 + 7$	5	$18 - 7$
	14	

LIVEWORKSHEETS