1. Use the diagram below to answer the following questions.

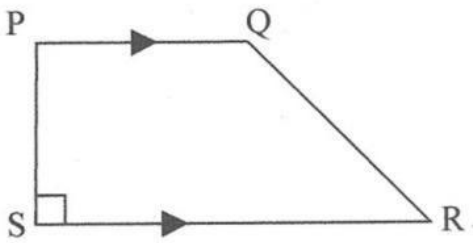

(i) State the pair of parallel lines.

Answer: _____ [1]

(ii) State a pair of perpendicular lines.

Answer: _____ [1]

1. Below is an addition wall. Fill in the values in the two bricks that are blank.

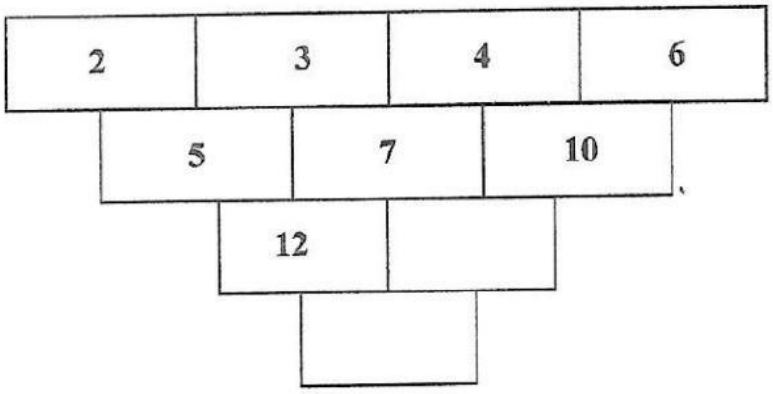

Answer: _____ , _____ [2]

1. Write 0.007 as a fraction

Answer: _____ [1]

LIVEWORKSHEETS

1. Using the letter x write the inequality for the graph below.

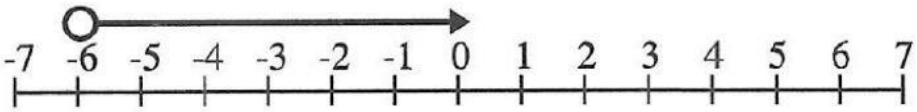

Answer: _____ [2]

1. Travelling at 48 km/h, how far would a car travel in 5 hours?

Answer: _____ km [2]

1. **Evaluate:** $3^2 + \sqrt{121}$

Answer: _____ **[3]**

1. A month was chosen from the months of the year.

Find the probability of selecting a month

(a) starting with A,

Answer: _____ [1]

LIVEWORKSHEETS

(b) ending with a ***Y***,

Answer: _____ [1]

(c) starting with ***R***.

Answer: _____ [1]

LIVEWORKSHEETS