# LKPD

# MATEMATIKA

## UNTUK SISWA SD KELAS III

LIVEWORKSHEETS

Nama : _____

Kelas : _____

# Mengenal Bangun Ruang

Hubungkan gambar dengan nama yang sesuai!

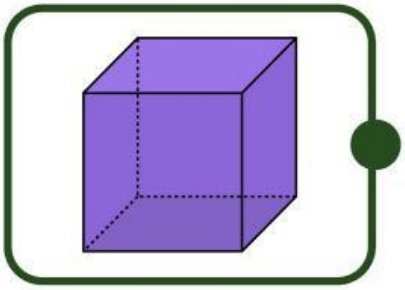

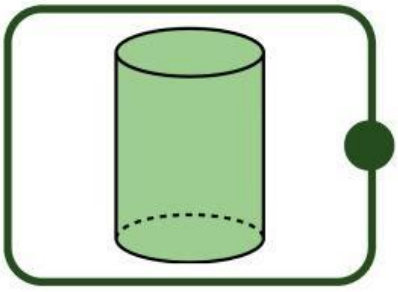

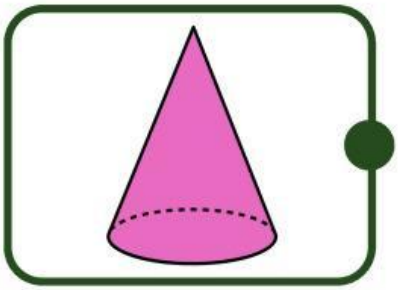

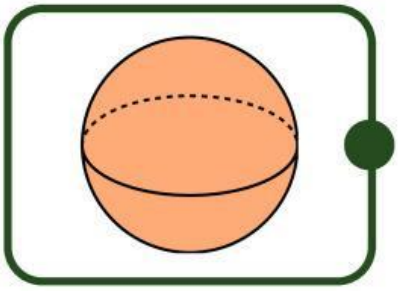

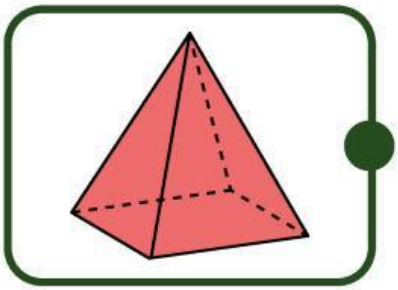

TABUNG

BOLA

KUBUS

LIMAS

KERUCUT

LIVEWORKSHEETS

Nama:

Tanggal:

# TEKA-TEKI CARI KATA

Temukan kosa kata tersembunyi yang berkaitan dengan bangun ruang

| | | | | | | | | | | | | | |
|---|---|---|---|---|---|---|---|---|---|---|---|---|---|
| Y | L | B | O | L | A | A | S | I | S | B | I | O | K |
| U | Y | M | T | Z | N | V | K | X | P | S | U | Q | Z |
| I | Q | E | E | N | H | E | S | O | G | D | H | T | U |
| S | C | K | E | X | S | M | T | Q | J | R | K | G | D |
| A | D | D | E | U | W | R | I | I | H | E | N | Y | F |
| K | H | A | H | R | T | I | U | U | K | U | F | L | Y |
| I | I | S | H | O | U | O | K | V | B | E | A | M | T |
| N | X | O | T | A | A | C | C | A | U | M | T | U | N |
| P | R | I | S | M | A | X | T | K | I | J | Y | I | S |
| M | Q | I | H | B | S | I | K | N | H | X | A | F | U |
| O | W | A | G | L | G | C | G | Z | X | Y | T | Y | L |
| K | R | L | A | I | N | W | O | E | H | C | P | H | P |
| G | G | K | D | W | U | G | S | P | K | U | B | U | S |
| L | I | M | A | S | D | M | O | K | C | X | Q | F | I |

- ☐ TABUNG
- ☐ KUBUS
- ☐ BOLA
- ☐ KERUCUT
- ☐ LIMAS
- ☐ PRISMA

LIVEWORKSHEETS

Nama: Absen:

# Beri tanda centang pada gambar yang merupakan bangun ruang

LIVEWORKSHEETS

Nama: _____ Kelas: _____

# Memahami Bangun Datar

Tulislah nama bangun datar pada gambar di bawah ini!

Nama : ..... Nama : ..... Nama : .....

LIVEWORKSHEETS

Nama: Absen:

# Beri tanda centang pada gambar yang bukan merupakan bangun ruang

LIVEWORKSHEETS