LEMBAR KERJA PESERTA DIDIK

LKPD

MATEMATIKA



NAMA :

KELAS :

LIVEWORKSHEETS

AMATI TEKA TEKI YANG TERSEDIA LALU ISI KOLOM YANG KOSONG DENGAN JAWABAN YANG TEPAT

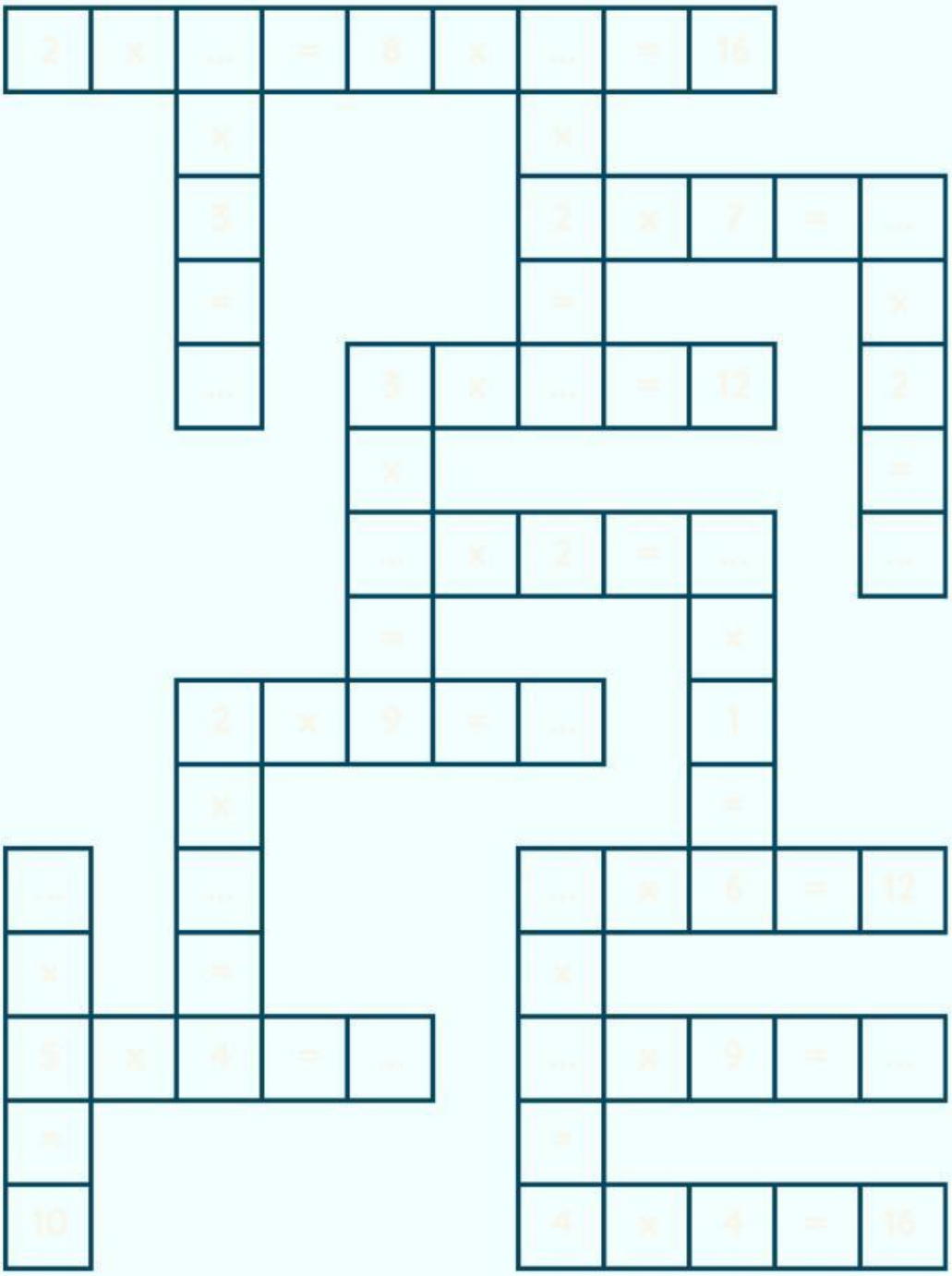

LIVEWORKSHEETS

Penjumlahan Domino

Hitunglah jumlah domino berikut.

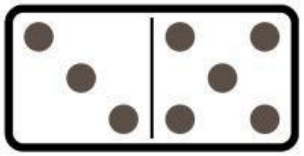

3 + 5 = 8



4 + 4 = ____

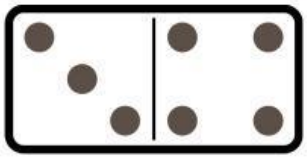

3 + 4 = ____

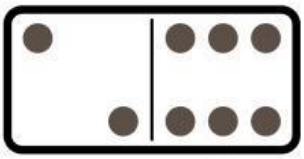

2 + 6 = ____



5 + 3 = ____

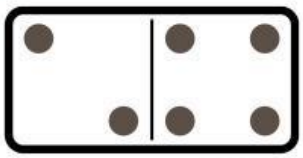

2 + 4 = ____

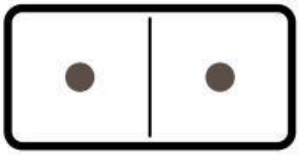

1 + 1 = ____



6 + 6 = ____



1 + 6 = ____

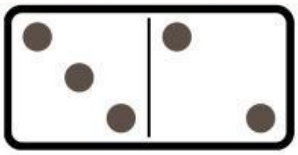

3 + 2 = ____



5 + 5 = ____

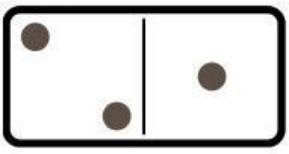

2 + 1 = ____



6 + 3 = ____

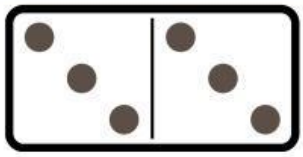

3 + 3 = ____

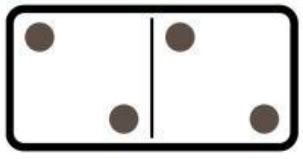

2 + 2 = ____

LIVEWORKSHEETS

PENJUMLAHAN

Ayo menghitung buah – buahan berikut !

LIVEWORKSHEETS

GARIS BILANGAN

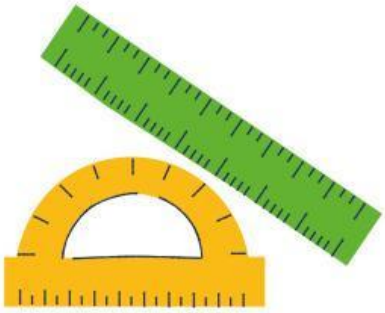

Lengkapilah garis bilangan berikut dengan bilangan yang benar!

1. Isilah titik-titik berikut dengan angka 0 sampai 11!

0 1 2 ... 4 ... ... 8 11

2. Isilah titik-titik berikut dengan angka yang tepat!

... 12 ... ... 15 ... ... 18 ... 20 ... ...

3. Isilah titik-titik berikut dengan angka 29 sampai 39!

29 ... 30 ... 32 ... ... 36 39

4. Isilah titik-titik berikut dengan angka yang tepat!

45 ... ... 49 ... ... 52 ... ... 55 ...

5. Isilah titik-titik berikut dengan angka yang tepat!

... 62 ... ... 66 ... ... 69 ... 71 ...

LIVEWORKSHEETS

Nama : Kelas :

PUZZLE PERKALIAN

Kerjakanlah operasi hitung perkalian di bawah ini agar kamu dapat menyatukan gambar dengan tepat!

3 x 3	4 x 5	5 x 6	6 x 2	7 x 2	8 x 1	9 x 2
3 x 6	4 x 7	5 x 8	6 x 4	7 x 6	8 x 2	9 x 8
3 x 7	4 x 8	5 x 7	6 x 8	7 x 8	8 x 8	9 x 9
3 x 9	4 x 9	5 x 9	6 x 9	7 x 9	8 x 10	6 x 10

LIVEWORKSHEETS