LKPD

Matematika Kelas 1

Penjumlahan dan Pengurangan Sampai dengan 20

Nama: _____ No.Absen: _____

LIVEWORKSHEETS

CARI NILAIKU

Hitunglah benda dibawah ini, dan temukan jawabannya!

1

2

3

4



5



4

9

2

8

3

LIVEWORKSHEETS

PILIHLAH JAWABAN YANG BENAR!

centanglah angka yang sesuai dengan jumlah gambar!

1

5 6 7

2



11 10 9

3

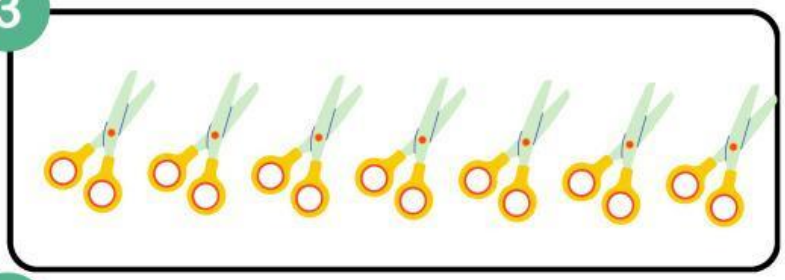

8 7 9

4



1 3 4

5

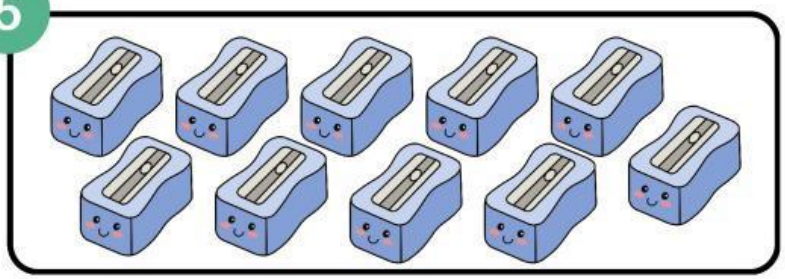

12 10 11

LIVEWORKSHEETS

POHON APEL

Bantu petani merapikan pohon apel ini, yuk! Hitung soal di setiap apel putih, lalu pasangkan dengan jawaban yang tepat pada apel merah di bawahnya!



LIVEWORKSHEETS

HITUNG BENDA

Hitunglah benda di bawah ini lalu jawablah dengan benar!

1



2

3



4

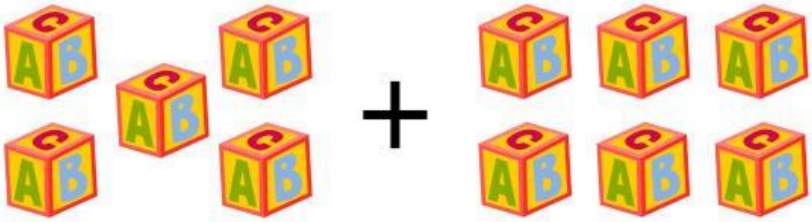

5

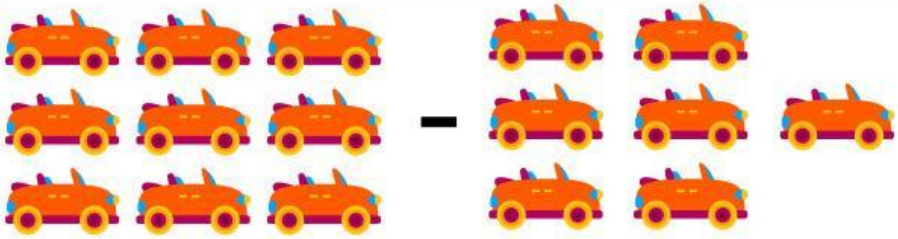

LIVEWORKSHEETS

BERHITUNG JUMLAH

Hitung banyaknya jumlah dari masing-masing gambar, isikan di kotak yang sudah tersedia!



=

=

=

=

LIVEWORKSHEETS