Nama:

Kelas:

# LEMBAR KERJA PESERTA DIDIK

## MATEMATIKA

LIVEWORKSHEETS

# TABEL 100

Lengkapi kotak-kotak yang kosong dengan angka yang sesuai sehingga lengkap sampai 100.

| | | | | | | | | | |
|---|---|---|---|---|---|---|---|---|---|
| 1 | | | | | | | | | |
| | | | | | | | 18 | | |
| | 22 | | | | | | | | 30 |
| | | | | | | | | | |
| | | | | | | | | | 50 |
| | | | | 55 | | | | | |
| | | | | | | | | | |
| | | | | | | | | | 80 |
| | | | 84 | | | | | | |
| | | | | | | | | | 100 |

LIVEWORKSHEETS

# PENJUMLAHAN

Tuliskan angka yang hilang agar kalimat matematikanya menjadi benar

| | | | |
|---|---|---|---|
| 10 | 10 | 10 | 10 |
| ☐ + 7 | 8 + ☐ | 5 + ☐ | 4 + ☐ |
| 15 | 17 | 16 | 19 |
| ☐ + 10 | ☐ + 10 | ☐ + 10 | ☐ + 10 |
| ☐ | ☐ | ☐ | ☐ |
| 3 + 10 | 2 + 10 | 5 + 10 | 7 + 10 |
| 15 | 9 | 12 | 8 |
| ☐ + 5 | ☐ + 3 | ☐ + 10 | ☐ + 6 |
| ☐ | ☐ | ☐ | ☐ |
| 5 + 3 | 6 + 7 | 2 + 6 | 4 + 8 |

LIVEWORKSHEETS

# PENJUMLAHAN

Lingkari nilai yang sesuai dengan jumlah pada gambar

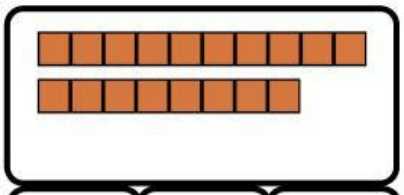

10 18 15

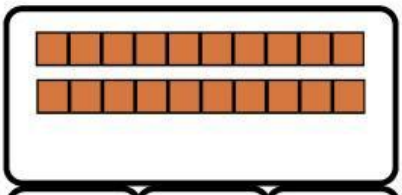

10 20 30

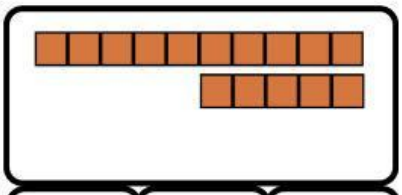

15 16 17

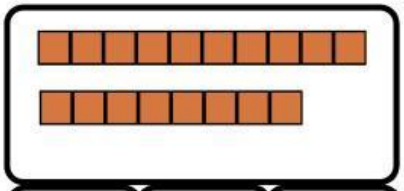

18 19 20

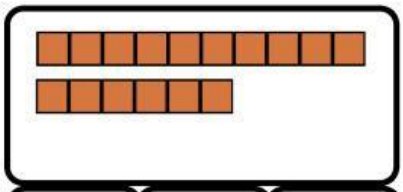

14 18 16

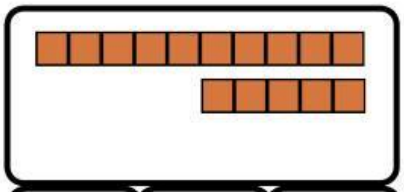

19 17 15

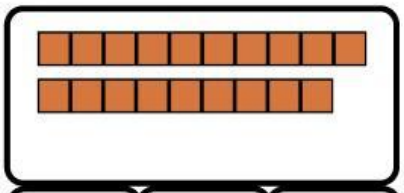

18 19 29

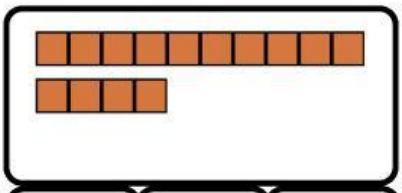

14 16 18

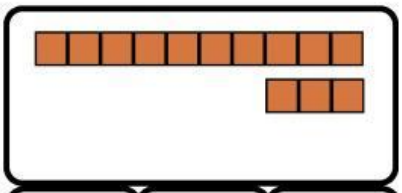

12 13 14

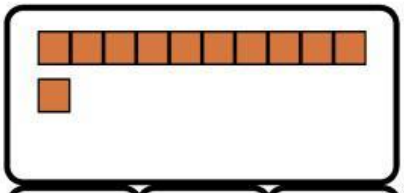

9 10 11

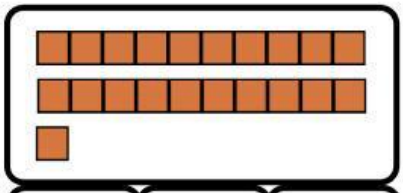

23 22 21

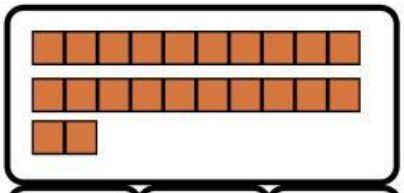

23 22 21

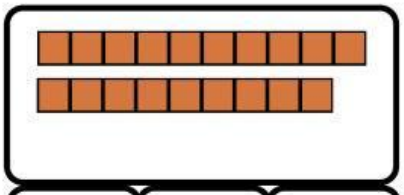

10 14 19

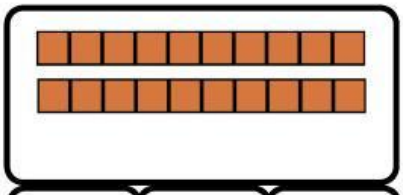

10 20 30

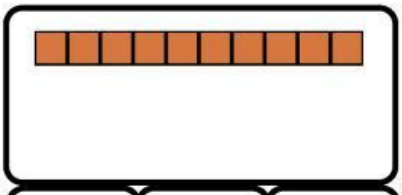

10 9 8

LIVEWORKSHEETS

# PENGURANGAN

Beri tanda silang sesuai kalimat matematika kemudian hitung dan tulis hasilnya

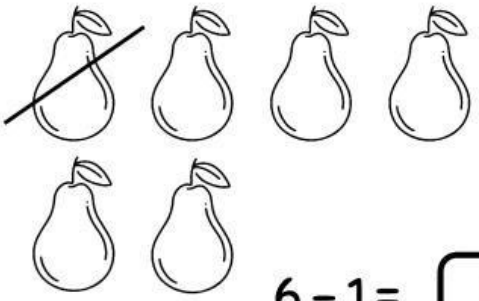

6 – 1 = 5



4 – 2 = ☐



11 – 6 = ☐

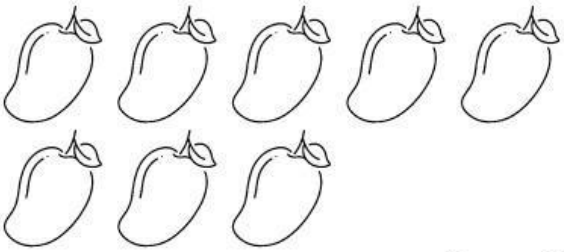

8 – 5 = ☐

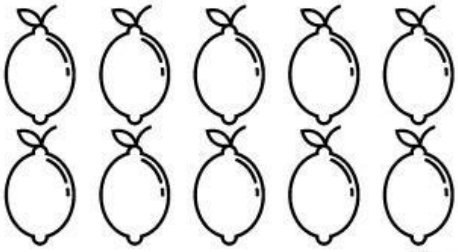

10 – 6 = ☐

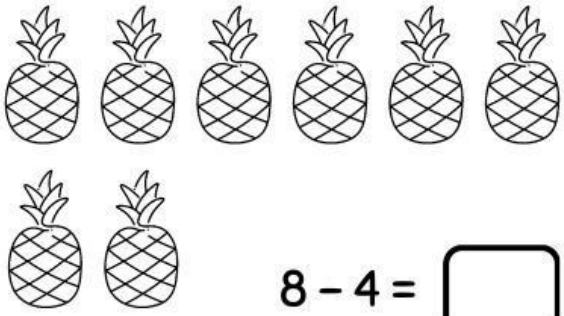

8 – 4 = ☐

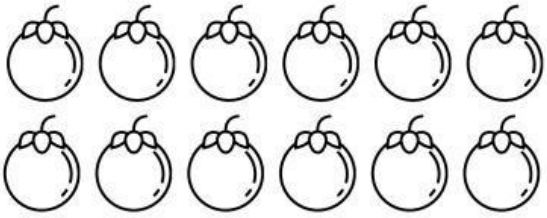

12 – 7 = ☐



9 – 9 = ☐

LIVEWORKSHEETS

# PENGURANGAN

Hitung dan tuliskan jumlah hewan di tiap kotak. Beri tanda silang sesuai kalimat matematika kemudian hitung dan tulis hasilnya



6 - 2 = 4



__ - 1 = __

__ - 4 = __



__ - 5 = __



__ - 6 = __



__ - 1 = __

__ - 2 = __

__ - 3 = __

LIVEWORKSHEETS