LKPD

Matematika

Tema: Pecahan

Nama: _____

Kelas: _____

LIVEWORKSHEETS

LKPD
Bilangan Pecahan

Perhatikan Video berikut ini

Perhatikan materi presentasi berikut

PPTX

WWW

Materi

Materi

LIVEWORKSHEETS

Pecahan dan Pembilang Satu

Perhatikan gambar, Tulislah pecahan di bawah ini.

1



5

2

6

3

7

4

8



LIVEWORKSHEETS

Pecahan Senilai

Hubungkan setiap pecahan yang memiliki jumlah senilai.

$\frac{2}{6}$ •	• $\frac{2}{4}$
$\frac{1}{5}$ •	• $\frac{4}{12}$
$\frac{1}{2}$ •	• $\frac{4}{10}$
$\frac{3}{4}$ •	• $\frac{2}{10}$
$\frac{1}{4}$ •	• $\frac{1}{3}$
$\frac{2}{5}$ •	• $\frac{2}{8}$

LIVEWORKSHEETS

Perbandingan Pecahan

Tulis pecahan dan bandingkan pecahan dengan notasi lebih dari (>) atau kurang dari (<) di bawah ini.

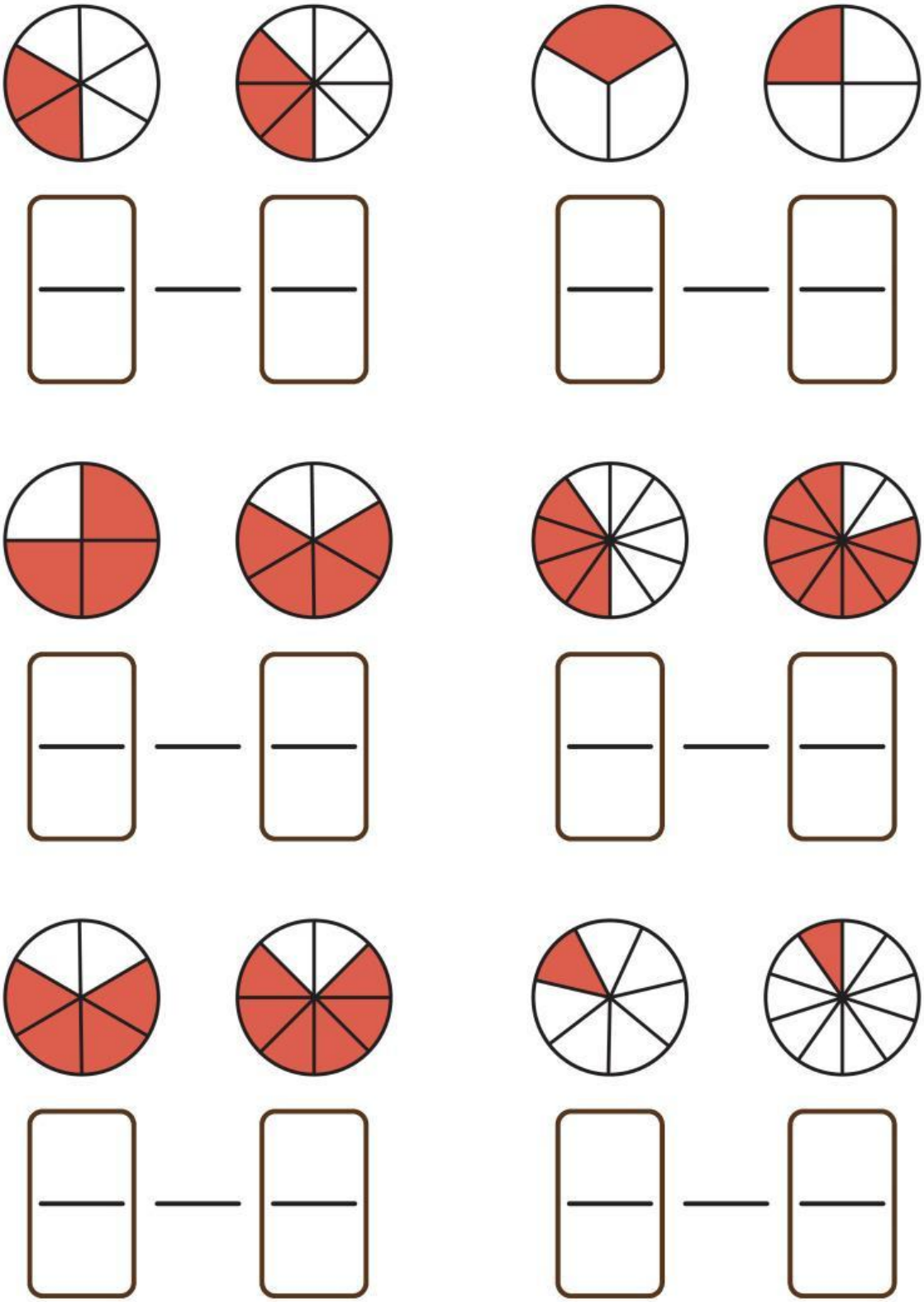

LIVEWORKSHEETS

Pecahan Desimal

Tulis bagian dalam kotak sebagai pecahan biasa, kemudian ubahlah menjadi pecahan desimal.

$\frac{\square}{\square} = \square$



$\frac{\square}{\square} = \square$

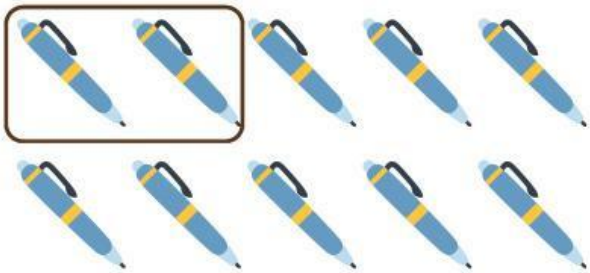

$\frac{\square}{\square} = \square$

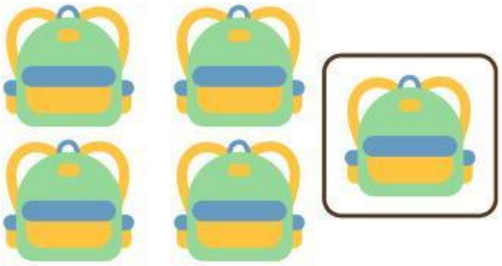

$\frac{\square}{\square} = \square$

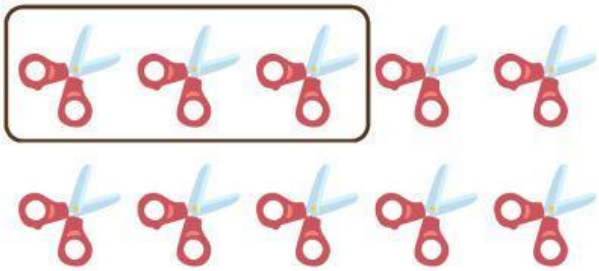

$\frac{\square}{\square} = \square$

LIVEWORKSHEETS