Name: _____ Class: _____

Private Lesson
+62 896-7395-5244

Practice 2 Angles at a Point

(1) In each of the following diagrams, the lines meet at a point. Find the unknown marked angles.

(a)

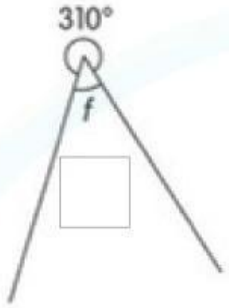

(b)

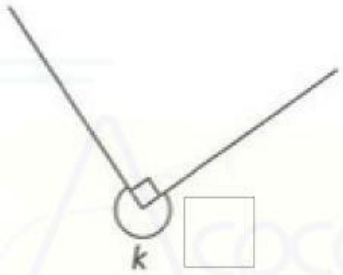

(c)

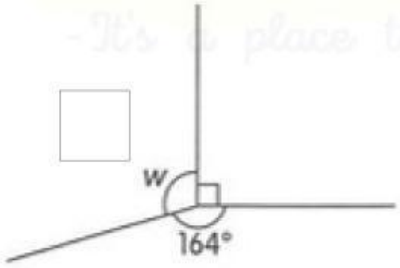

(d)

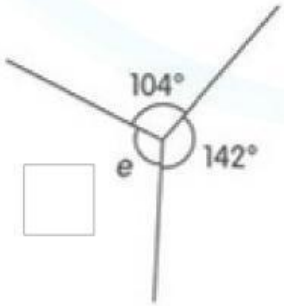

LIVEWORKSHEETS

Private Lesson
+62 896-7395-5244

(e)

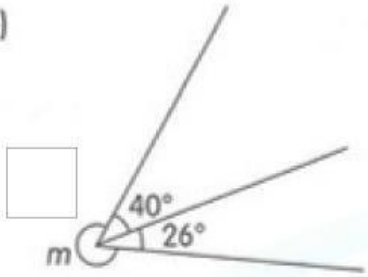

(f)

(g)

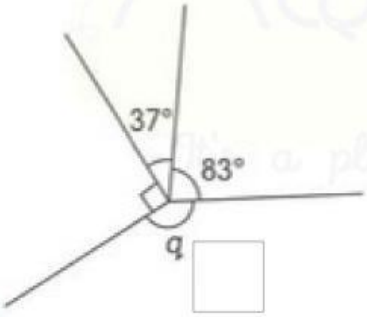

(h)

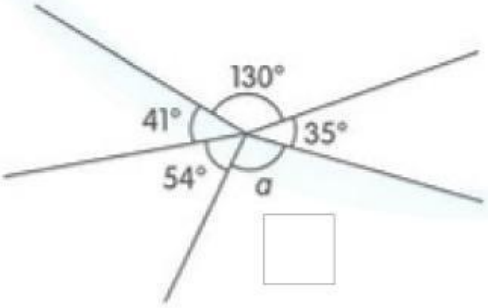

LIVEWORKSHEETS