LKPD
MATEMATIKA

Penjumlahan

Nama:

Kelas:

LIVEWORKSHEETS

Nama: _____ Kelas: _____

CODING PENJUMLAHAN

Isilah kotak di bawah ini sesuai dengan kode pada tabel!

1	2	3	4	5	6	7	8	9



☐ + ☐ = ☐



☐ + ☐ = ☐



☐ + ☐ = ☐



☐ + ☐ = ☐

☐ + ☐ = ☐

☐ + ☐ = ☐

LIVEWORKSHEETS

Nama: _____ Kelas: _____ Nilai: _____

Penjumlahan Dadu Warna

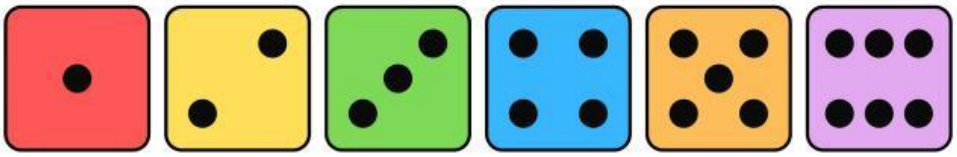

1	+	2	=	3		+	=
	+		=			+	=
	+		=			+	=
	+		=			+	=
	+		=			+	=
	+		=			+	=
	+		=			+	=
	+		=			+	=
	+		=			+	=

LIVEWORKSHEETS

Nama: Kelas:

CODING PENJUMLAHAN

1	2	3	4	5	6	7	8	9

Lihat kode angka setiap kue, tuliskan nilainya, lalu hitung jumlahnya pada kotak jawaban.

= 5 + 2 + 3 = 10

=

=

=

=

LIVEWORKSHEETS