LEMBAR KERJA PESERTA DIDIK
MATEMATIKA

NAMA : _____ **KELAS :** _____

1. Tuliskan nama bangun ruang berikut pada tempat yang tersedia.

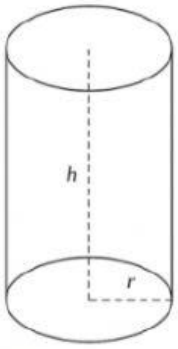

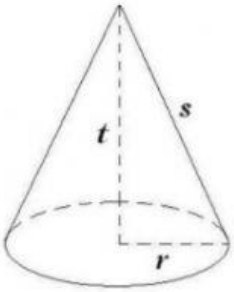

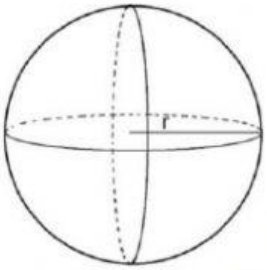

2. Pasangkan rumus volume yang tepat untuk bangun ruang berikut:

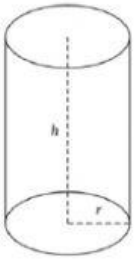

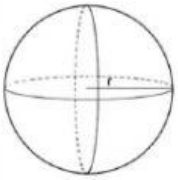

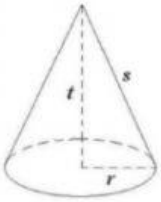

$V = \frac{1}{3} \times \pi \times r^2 \times t$

$V = \pi \times r^2 \times t$

$V = \frac{4}{3} \times \pi \times r^3$

LIVEWORKSHEETS

3. Luas permukaan dari sebuah tabung yang berjari-jari 7 cm dengan tinggi tabung 10 cm adalah .....
   a. 648 cm^2
   b. 748 cm^2
   c. 848 cm^2
   d. 948 cm^2

4. Pasangkanlah bagian-bagian tabung berikut:

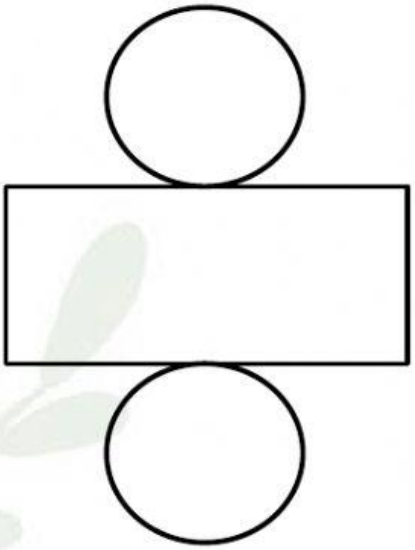

Selimut Tabung

Alas Tabung

Atas/Tutup Tabung

"Selamat Bekerja"

LIVEWORKSHEETS