48 Multipliquem descomponent

1. Calcula les multiplicacions següents (Fes servir desenes exactes)

	10	4
2	20	8

14 × 2 = 28

36 × 2 = _____

46 × 2 = _____

12 × 6 = _____

24 × 3 = _____

23 × 4 = _____

LIVEWORKSHEETS

Data:

2. Calcula les multiplicacions següents (Fes servir desenes exactes)

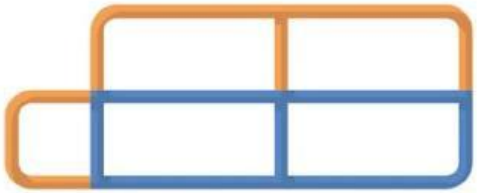

13 × 4 = _____

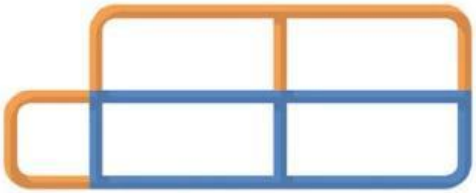

54 × 3 = _____

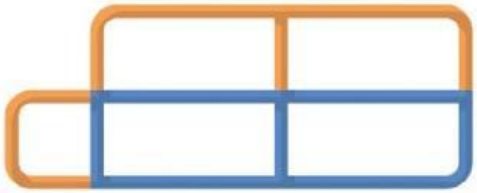

57 × 6 = _____

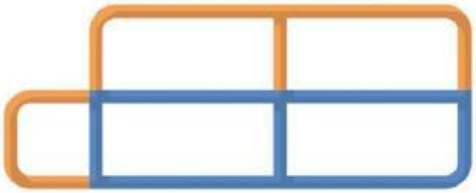

52 × 7 = _____

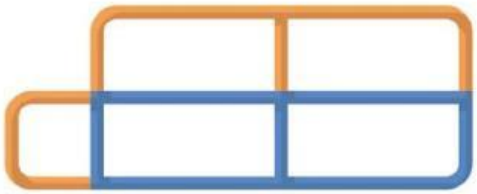

84 × 9 = _____

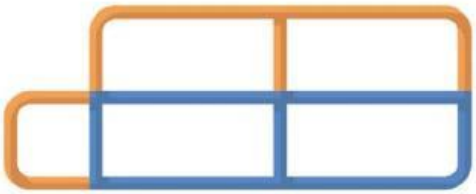

94 × 7 = _____

LIVEWORKSHEETS