# 48 Multipliquem descomponent

**1.** Respon.



- Quantes **files** hi ha? _____
- Quantes **columnes** hi ha? _____
- Quants **quadradets** hi ha **en total**? _____
- Completa la multiplicació: _____ × _____ = _____

**2.** Quants quadradets hi ha en cada cas? Completa.

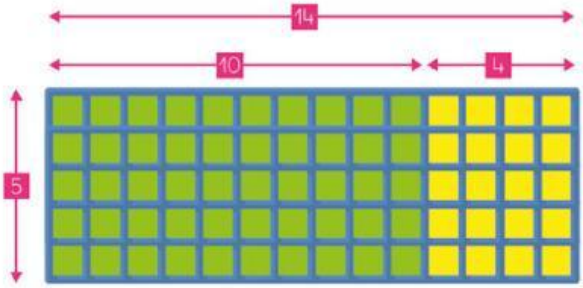


14 × 5 = _____



15 × 5 = _____

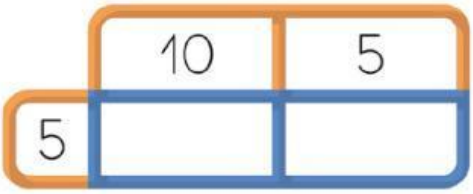




LIVEWORKSHEETS

Data:

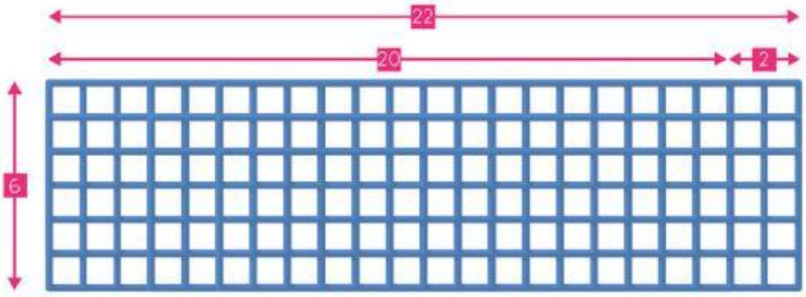


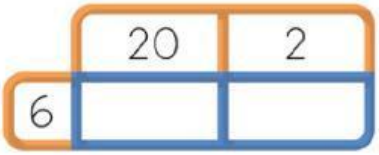


22 × 6 = .....

**3.** Calcula la multiplicació 12 × 4 de 2 maneres diferents. Pinta el rectangle segons la descomposició que facis.



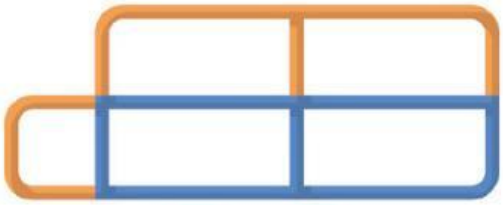

12 × 4 = .....

12 = 10 + 2



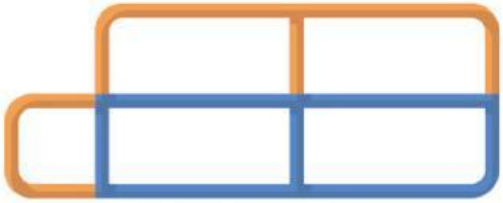

12 × 4 = .....

12 = ..... + .....



LIVEWORKSHEETS