MURRUD

Kirjuta iga kujundi juurde, kui suur osa on värvitud.

$= \frac{3}{5}$

LUGEJA
loeb, mitu osa on värvitud

NIMETAJA
nimetab, mitu osa on kokku

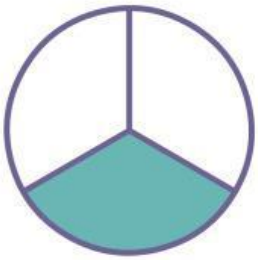

= _____

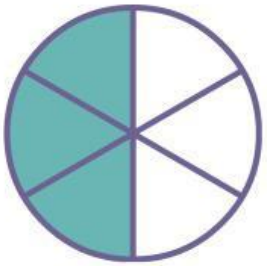

= _____

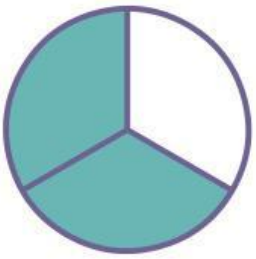

= _____



= _____



= _____

= _____



= _____

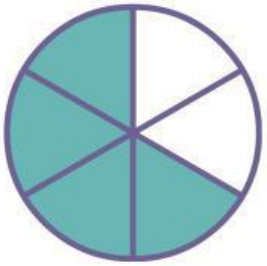

= _____

LIVEWORKSHEETS