TIPE SOAL PILIHAN GANDA

1) **Manakah gambar berikut yang merupakan segi empat, klik pada gambar yang tepat...**





TIPE SOAL SINGKAT

2) **Segitiga yang salah satu sudutnya $90^0$ disebut dengan segitiga....**

TIPE SOAL URAIAN PANJANG

3) **Peregi Panjang adalah...**

TIPE SOAL DROP DOWN

4) **Gambar bangun ruang di bawah ini adalah...**

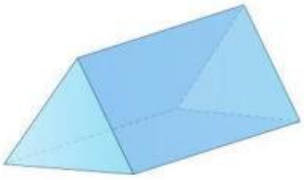

LIVEWORKSHEETS

TIPE MEMASANGKAN

**5) Pasangkanlah gambar berikut ini..**

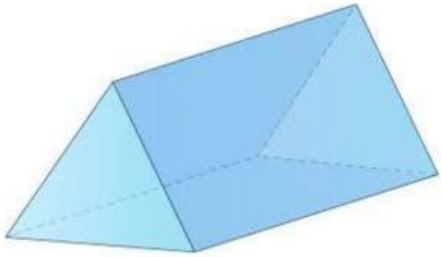

Limas

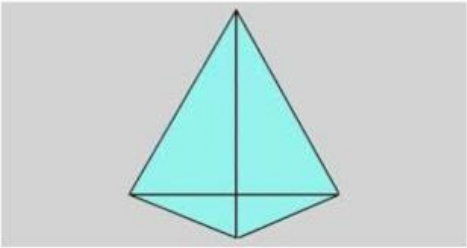

Prisma

SOAL DRAG AND DROP

**6) PINDAHKAN BANGUN RUANG DI BAWAH KE KOTAK YANG TEPAT**

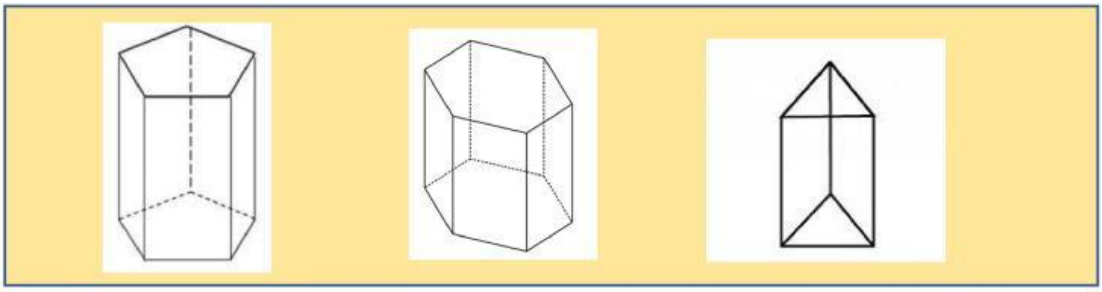

| | | |
|---|---|---|
| | | |
| **Prisma Segi Tiga** | **Prisma Segi Lima** | **Prisma Segi Enam** |

LIVEWORKSHEETS