Lembar Kerja Peserta Didik

LKPD

Nama : _____

Kelas : _____

LIVEWORKSHEETS

AYO HITUNG JUMLAH BENDA!

Tariklah garis, pasangkan benda yang sama banyak.

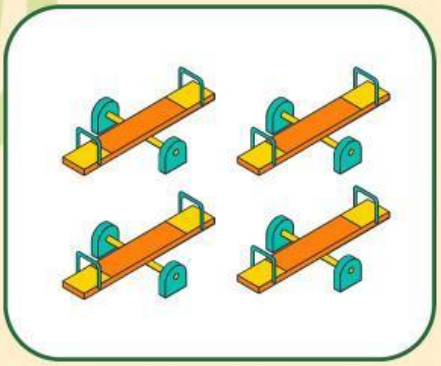

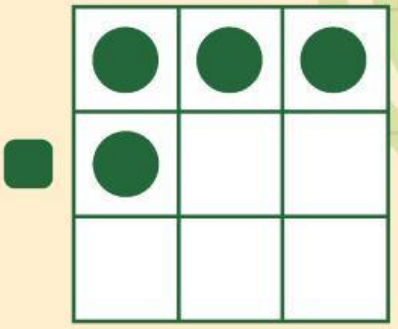



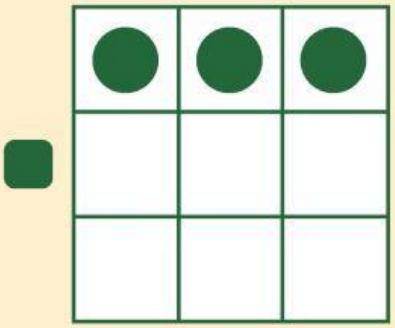

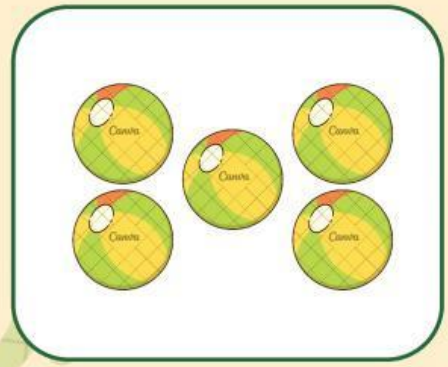

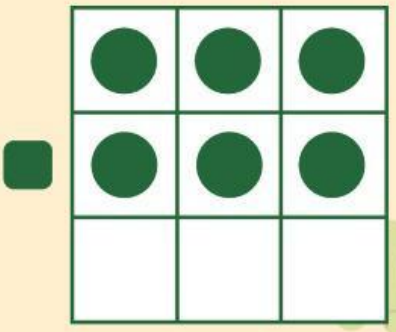



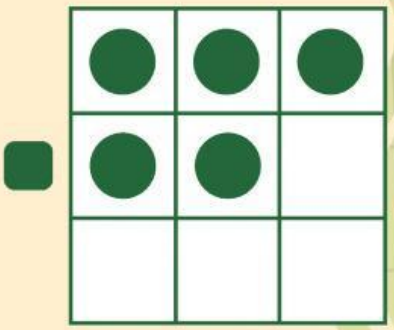

LIVEWORKSHEETS

AYO BANDINGKAN JUMLAH BENDA!

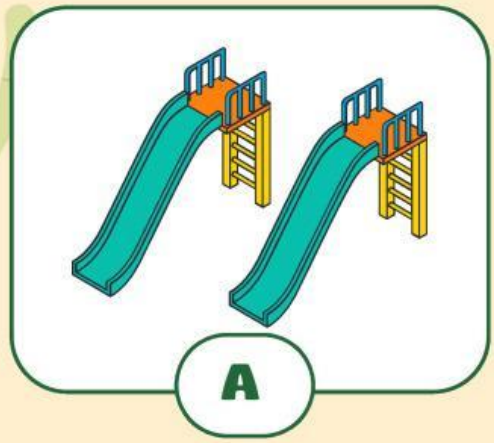

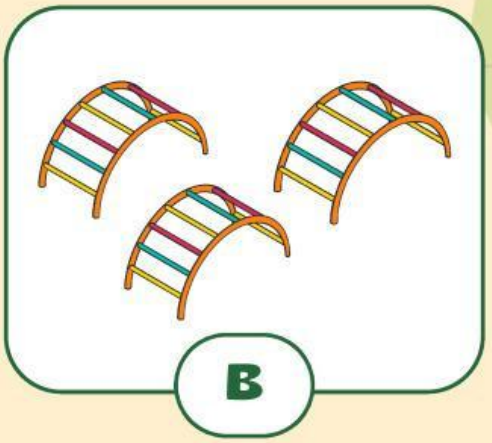

Benda mana yang jumlahnya lebih banyak? .....

Benda mana yang jumlahnya lebih sedikit? .....

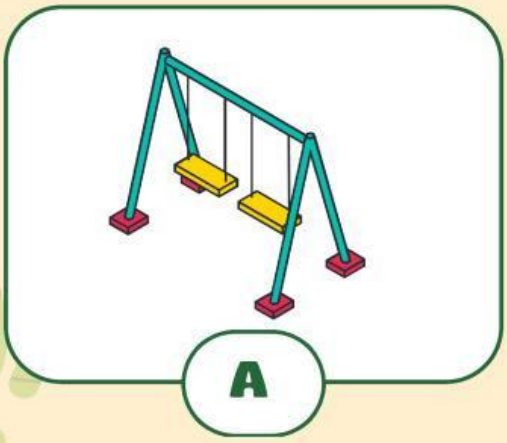

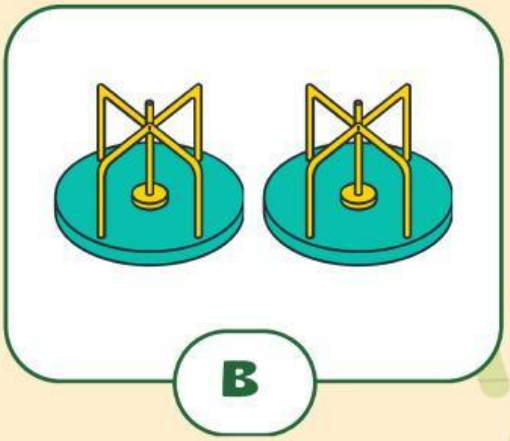

Benda mana yang jumlahnya lebih banyak? .....

Benda mana yang jumlahnya lebih sedikit? .....

LIVEWORKSHEETS

AYO LENGKAPI URUTAN BILANGAN BERIKUT!

Lengkapi bilangan mulai dari 1 sampai 10

Lengkapi bilangan mulai dari 10 sampai 1

LIVEWORKSHEETS

AYO TEMUKAN PASANGAN BILANGAN BERIKUT!



5

.....

.....



7

.....

.....



9

.....

.....

LIVEWORKSHEETS