TIPE SOAL PILIHAN GANDA

1) **Manakah gambar berikut yang merupakan segi empat, klik pada gambar yang tepat...**





TIPE SOAL SINGKAT

2) **Segitiga yang salah satu sudutnya 90^0 disebut dengan segitiga....**

TIPE SOAL URAIAN PANJANG

3) **Peregi Panjang adalah...**

TIPE SOAL DROP DOWN

4) **Gambar bangun ruang di bawah ini adalah...**

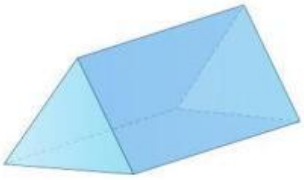

LIVEWORKSHEETS

TIPE MEMASANGKAN

5) Pasangkanlah gambar berikut ini..

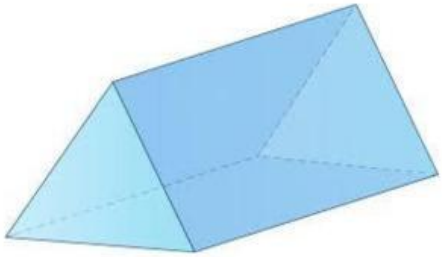

Limas

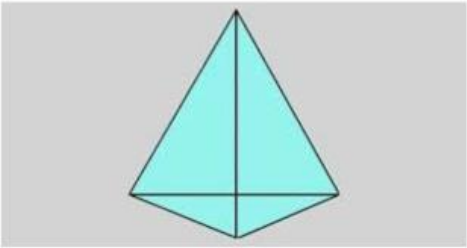

Prisma

SOAL DRAG AND DROP

6) PINDAHKAN BANGUN RUANG DI BAWAH KE KOTAK YANG TEPAT

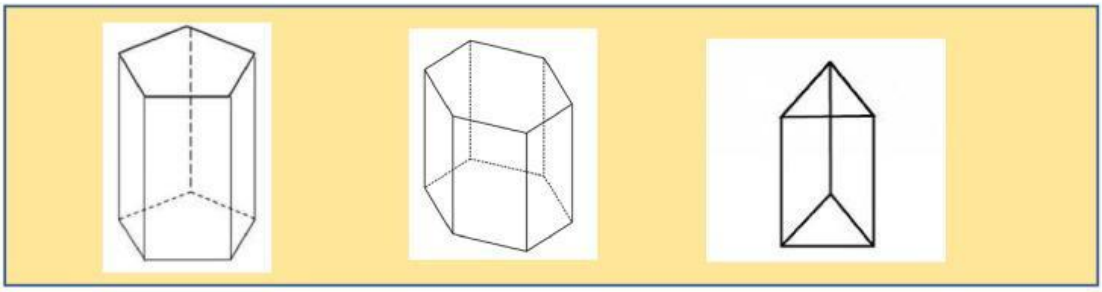

Prisma Segi Tiga	**Prisma Segi Lima**	**Prisma Segi Enam**

LIVEWORKSHEETS