5) Write the time as shown in each clock.

a)

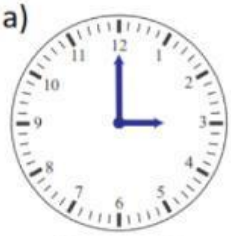

:

b)

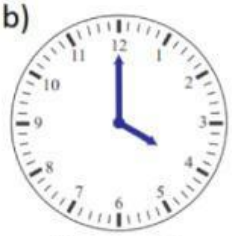

:

c)

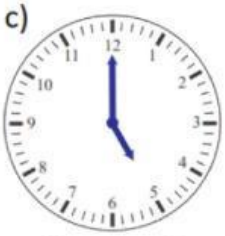

:

d)

:

e)

:

f)

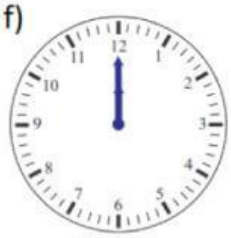

:

6) Write the hour.

a)

_____ O'Clock

b)

_____ O'Clock

c)

_____ O'Clock

d)

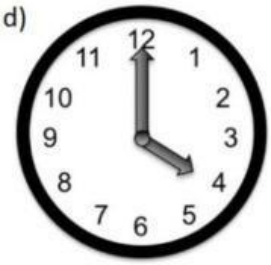

_____ O'Clock

e)

_____ O'Clock

f)



_____ O'Clock

LIVEWORKSHEETS