Cambridge Primary Mathematics 1

Worksheet 3

Name: _____ Date: _____ Class: _____

Part 1. Draw lines to match the ordinal number with the ordinal number word.

5th	fourth
2nd	eighth
6th	second
1st	tenth
10th	first
7th	third
3rd	ninth
8th	fifth
4th	seventh
9th	sixth

LIVEWORKSHEETS

Part 2. Read and answer the questions.

1st

How many cats are there before the 3rd cat? _____

How many cats are there after the 7th cat? _____

How many cats are there after the 5th cat? _____

How many cats are there after the 8th cat? _____

Part 3. Write the ordinal number of the coloured object in each row.



1)



2)

3)



LIVEWORKSHEETS

Part 4. Write the number sentence for each story.

1.

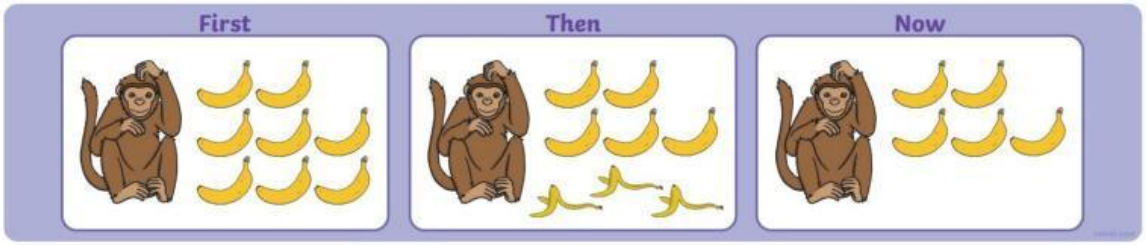

2.

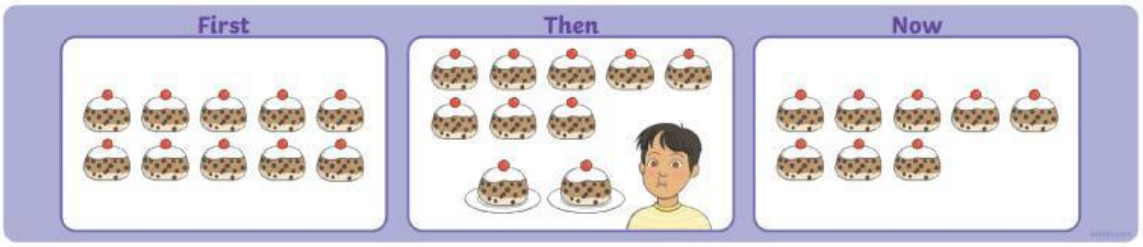

3. Aruna has 3 orange fish, 5 red fish and 1 black fish.

How many orange fish and black fish does Aruna have altogether?

Part 5. Complete each part-whole diagram. Write a number sentences for each diagram.

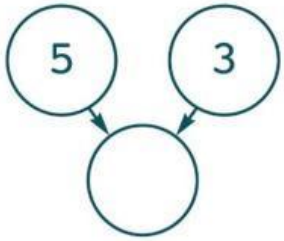

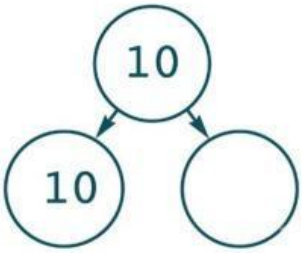

LIVEWORKSHEETS

Part 6. Where is the fox? Look, read and write the letter.

G

U

K

D

D in front of

between

under

in

on

next to

above

behind



I

L

N

C



LIVEWORKSHEETS

Part 7. Read and colour.



1. Above black is orange.

2. Left of orange is red.

2. Orange is between red and blue.

3. Below red is white.

4. Right of black is green.

Part 8.

1. Sort the shapes by writing the letters into the correct part of the Venn diagram.

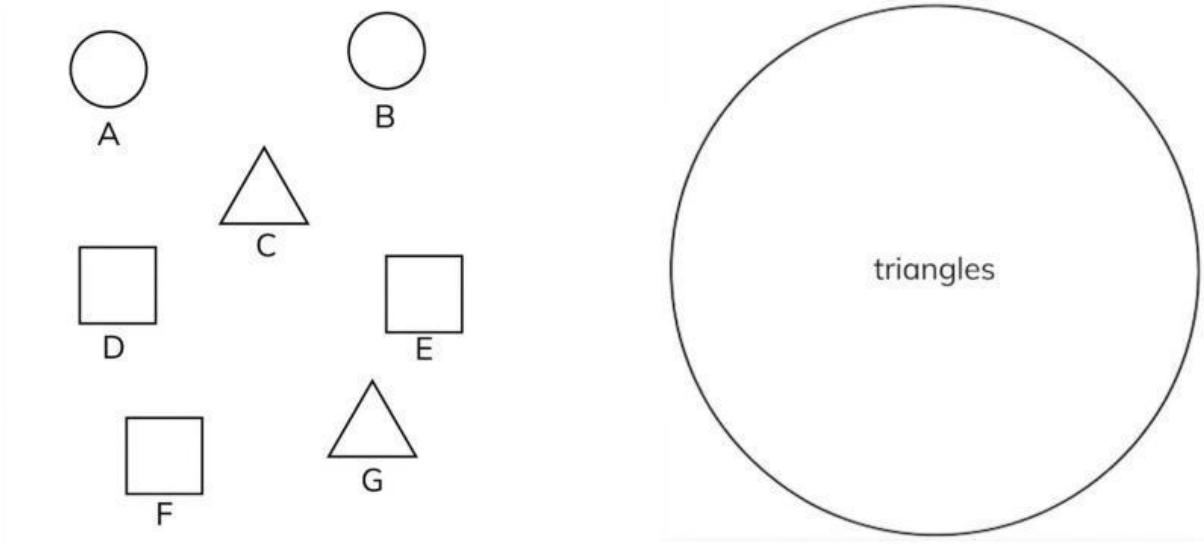

2. How many shapes are triangles? .....

3. How many shapes are not triangles? .....

4. How many shapes are there altogether? .....

5. Complete the sentence:

the same	**more**	**fewer**

There are ..... triangles than squares.

There are ..... squares than triangles.

__ THE END __

LIVEWORKSHEETS