Longer / Shorter

Grade 1 Measurement Worksheet

Look at the pictures in the boxes. Answer the question by circling the correct picture.

Which is longer? 	**Which is shorter?** 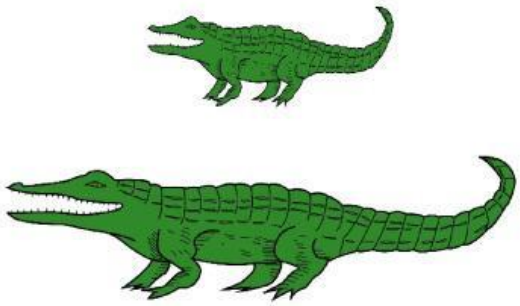
Which has shorter ears? 	**Which has longer legs?**
Which has a longer tail? 	**Which has a longer neck?** 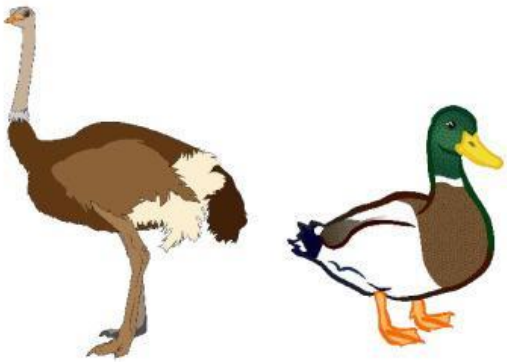

© www.k5learning.com
LIVEWORKSHEETS