الإسم:

نشاط فردي

أكتب الكسر الذي يمثّل الجزء الملوّن

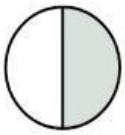

$\frac{١}{٢}$

____

____

____

____

____

____

____

الإسم:

نشاط فردي

أكتب الكسر الذي يمثّل الجزء الملوّن

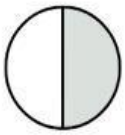

$\frac{١}{٢}$

____

____

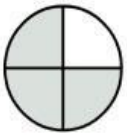

____



____

____

____

____

LIVEWORKSHEETS