COMPITI PER CASA

NUMERI DECIMALI SULLA LINEA DEI NUMERI

1. Osserva la linea dei numeri e completa le tabelle, come nell'esempio.

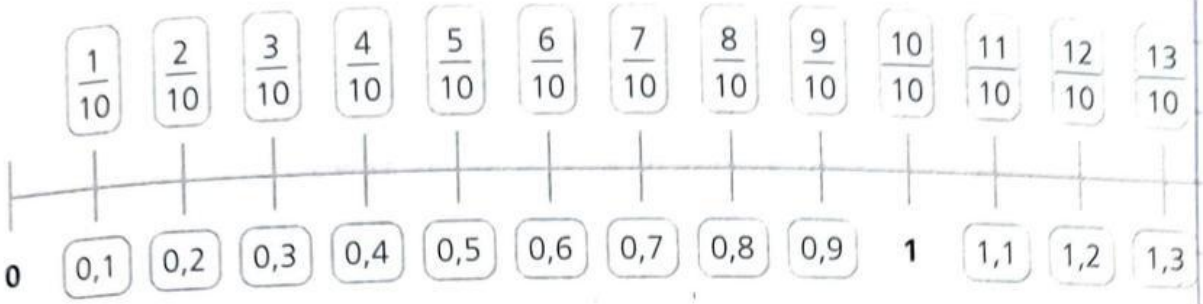

precede	numero	segue
0,1	0,2	**0,3**
	0,4	
	0,6	
	0,8	

precede	numero	segue
	0,9	
	1	
	1,1	
	1,2	

IL PERIMETRO DEI POLIGONI

- Misura con il righello i lati di ciascun poligono e scrivi le loro misure; poi calcola i perimetri.

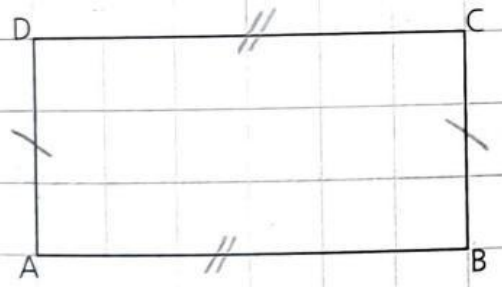

AB = ... cm BC = ... cm

CD = ... cm AD = ... cm

P = ... cm + ... cm + ... cm + ... cm = ... cm

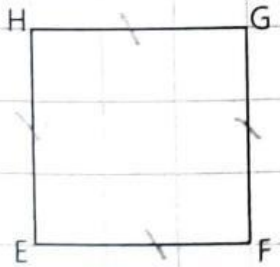

EF = ... cm FG = ... cm

GH = ... cm EH = ... cm

P = ... cm + ... cm + ... cm + ... cm = ... cm

LIVEWORKSHEETS

SE I COMPITI SONO TROPPI ... CONTINUIAMO ASSIEME A SCUOLA.

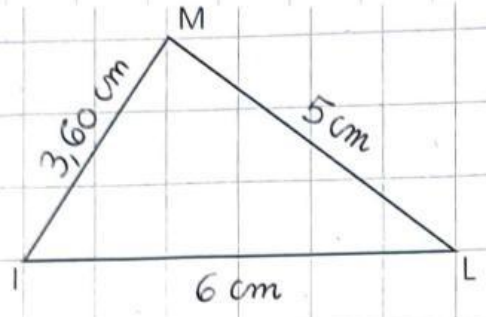

IL = ... cm LM = ... cm

IM = ... cm

P = ... cm + ... cm + ... cm = ... cm

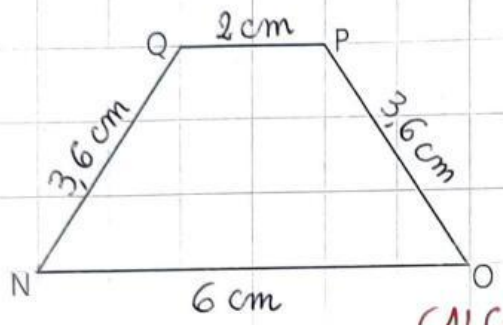

NO = ... cm OP = ... cm

PQ = ... cm NQ = ... cm

P = ... cm + ... cm + ... cm + ... cm = ... cm

CALCOLA IL PERIMETRO

LIVEWORKSHEETS