On My Own

Name _____

What is the sum? Show regrouping 10 ones as 1 ten.

1. 36 + 5 = _____

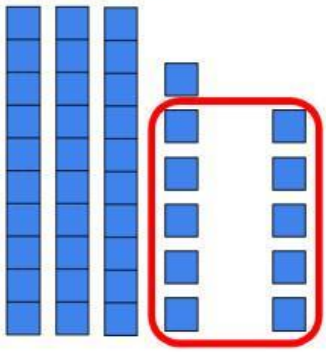

2. 65 + 8 = _____

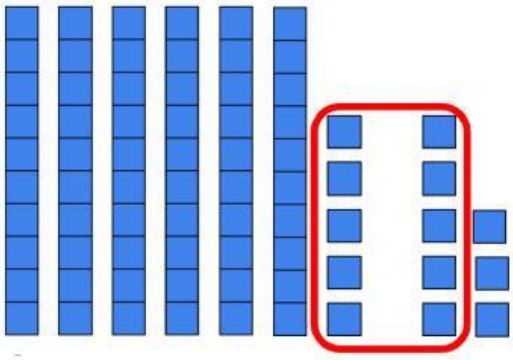

What is the sum?

3. 82 + 9 = _____

4. 6 + 79 = _____

5. 58 + 4 = _____

6. 7 + 47 = _____

Copyright © McGraw-Hill Education

LIVEWORKSHEETS

7. **Error Analysis** Marion uses blocks to add 38 + 8.

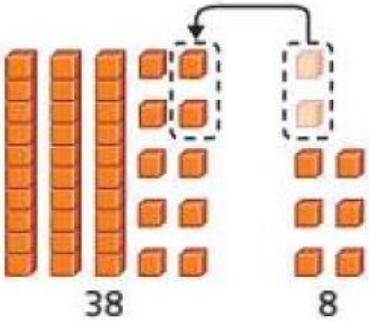

Marion says the sum is 48. How can you help Marion add correctly?

8. **Extend Your Thinking** Write an addition problem where you have to regroup to add. Then explain how to solve your addition problem.

Reflect

How can you regroup to add ones to a number?

Math is... Mindset

Why is it important to share your thinking clearly?

Copyright © McGraw-Hill Education

LIVEWORKSHEETS